**2.** Find the missing DISTANCES if all of the systems below have a **Moment of 200Nm.**

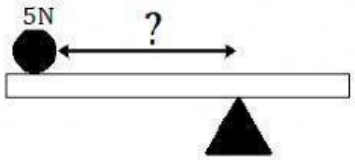


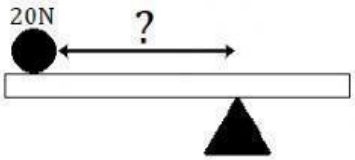


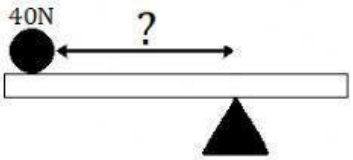


Distance = _____ / _____

= _____Nm / _____N

= _____ m

Distance = _____ / _____

= _____Nm / _____N

= _____ m

Distance = _____ / _____

= _____Nm / _____N

= _____ m

**3.** Find the missing FORCES if all of the systems below have a **Moment of 450Nm.**

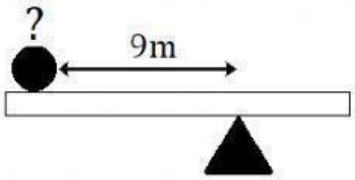


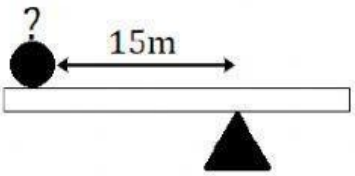


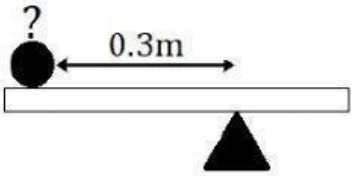


Force = _____ / _____

= _____Nm / _____m

= _____ N

Force = _____ / _____

= _____Nm / _____m

= _____ N

Force = _____ / _____

= _____Nm / _____m

= _____ N

LIVEWORKSHEETS