PPG prajabatan

MERDEKA BELAJAR

CLASH OF CHAMPIONS

ASESMEN DIAGNOSTIK

MATEMATIKA

KELAS VII

BY: HIKMAH MUTIARA

LIVEWORKSHEETS

Asesmen Diagnostik Kognitif

RONDE 1

LAMBANG BILANGAN

Pasangkan lambang bilangan dengan nama bilangan yang tepat

Negatif empat puluh delapan	12
Dua belas	2024
Tiga puluh enam	93
Negatif dua belas	36
Sembilan puluh tiga	-135
Dua ribu dua puluh empat	-12
Negatif seratus tiga puluh lima	22
Negatif seratus delapan	-76
Negatif tujuh puluh enam	-48
Dua puluh dua	-108

LIVEWORKSHEETS

GARIS BILANGAN

- Lengkapi Garis Bilangan berikut!

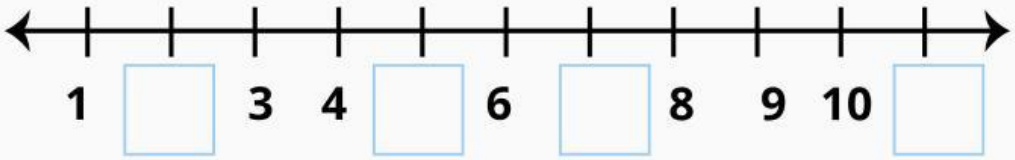

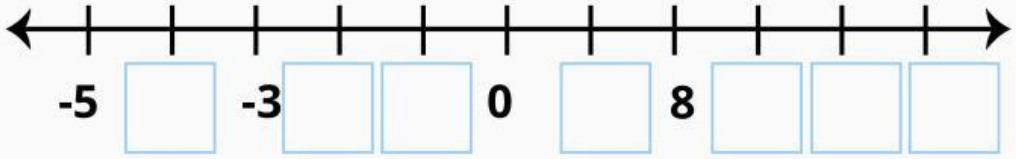

- Lengkapi Operasi Penjumlahan dan Pengurangan pada Garis Bilangan berikut!

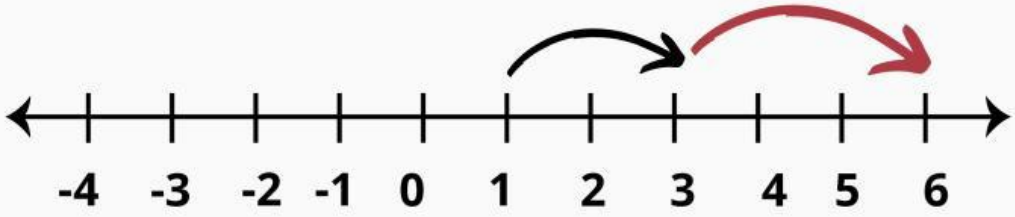

(-4)+5= ...

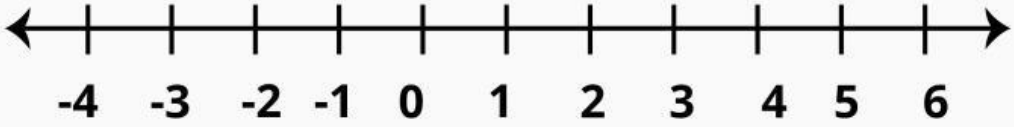

6+(-8)= ...

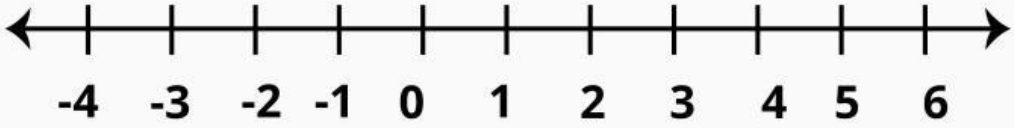

LIVEWORKSHEETS

RONDE 2

CARILAH NILAI KU

Isilah bagian yang kosong dengan cara melakukan perkalian angka pada lingkaran dan menghasilkan angka dalam toples.

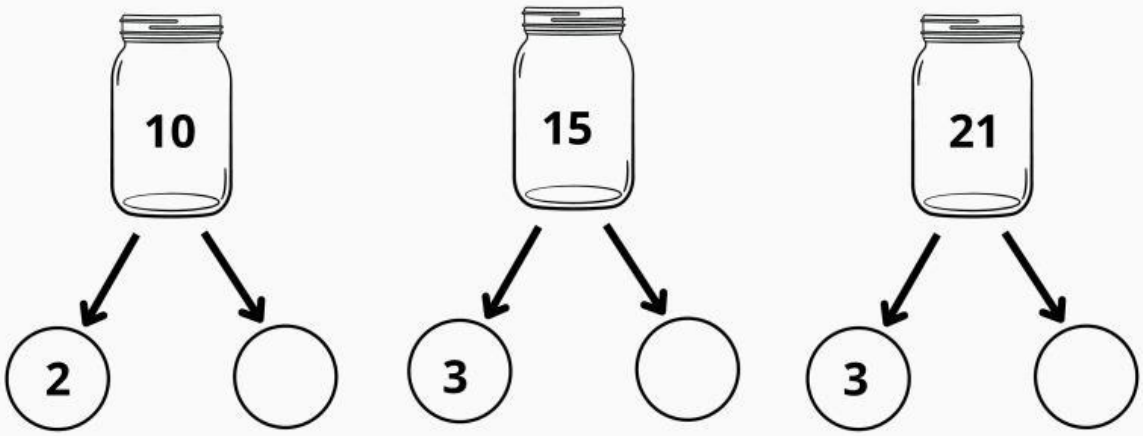

Lengkapi pohon faktor berikut!

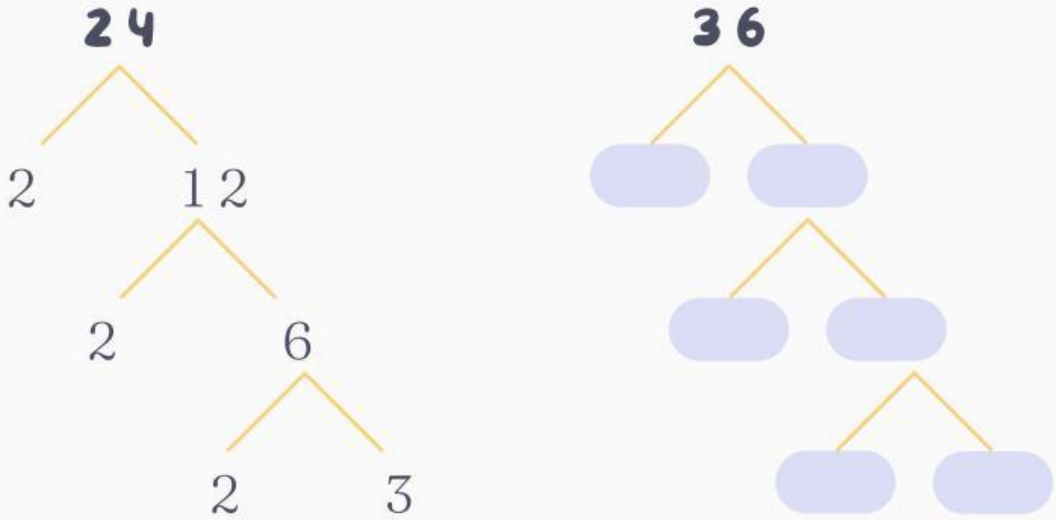

$$24 = 2 \times 2 \times 2 \times 3$$
$$= 2^3 \times 3$$

LIVEWORKSHEETS

MOZAIK MATEMATIKA

Hitunglah hasil masing-masing mozaik, lalu jumlahkan semuanya!

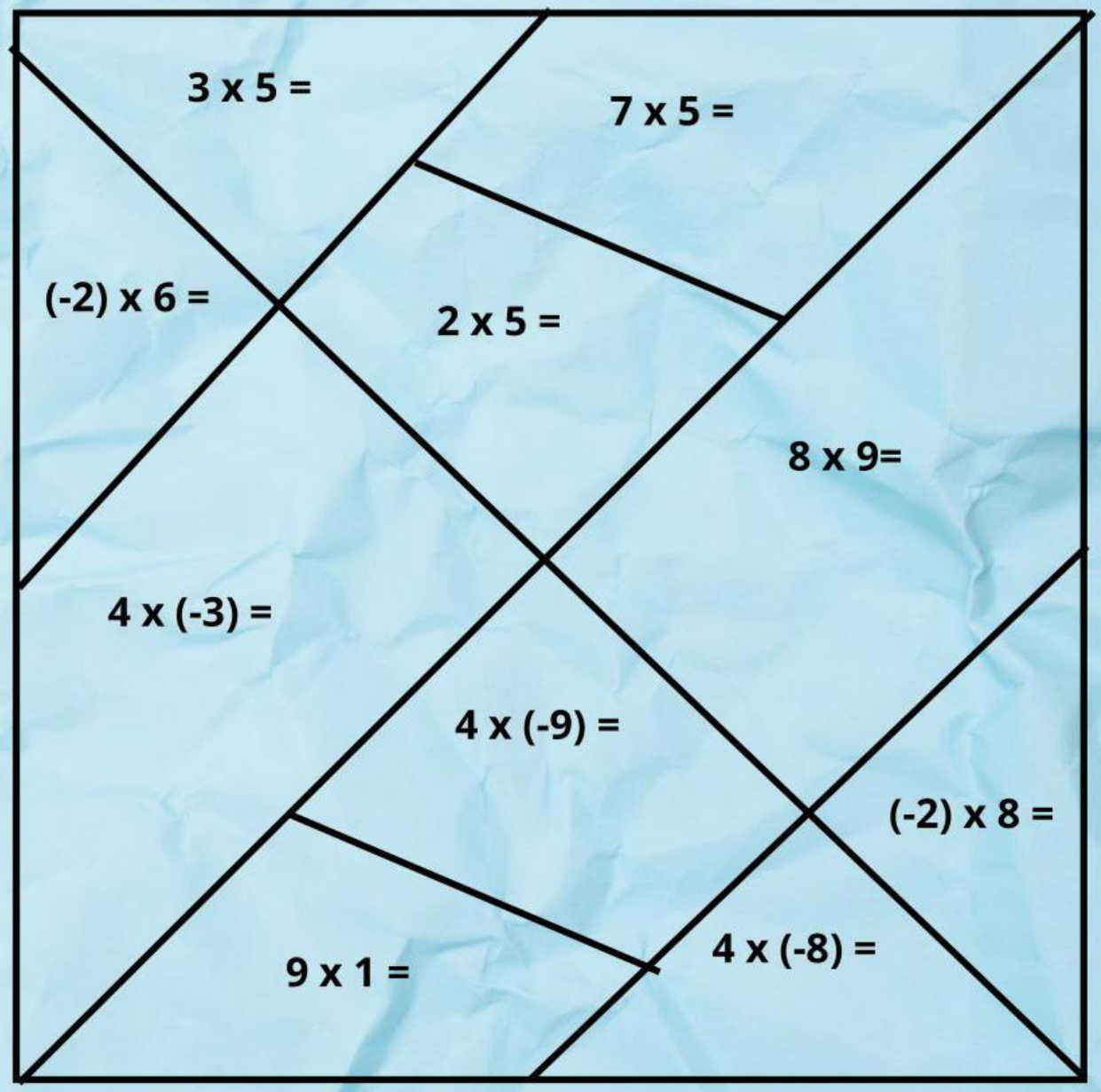

Jawaban

LIVEWORKSHEETS

RONDE 3

Hitung semua hasil operasi pada setiap bagian berikut!

$2 \times 3 + 4 - 2 =$

$(-20) + 14 \div (2+5) =$

$(-4) + 6 \times 5 =$

$(-3+7) \times 2 =$

Nilai:

LIVEWORKSHEETS