PENGUKURAN

Nama: **Kelas:**

Tulislah jawaban yang benar pada kolom yang disediakan!

A. Mengukur panjang dengan penggaris

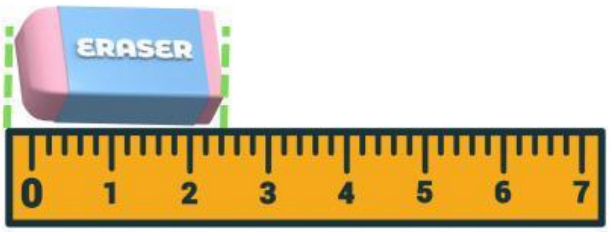

Panjang penghapus adalah.....

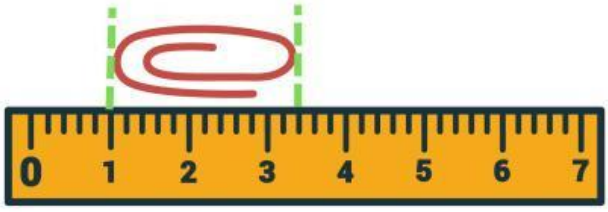

Panjang papper clip adalah.....

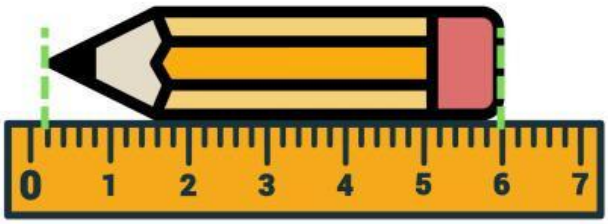

Panjang pensil adalah.....

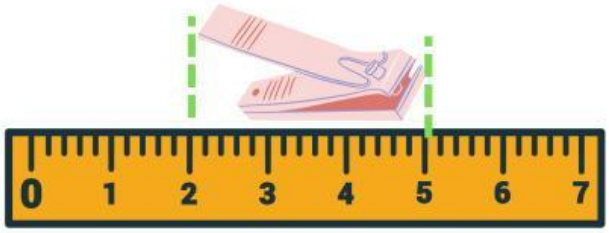

Panjang pemotong kuku mini adalah.....

LIVEWORKSHEETS

B. Mengukur Massa

Massa adek bayi adalah....

Tini ingin mengukur massanya. Hasil massa Massa Tini adalah....

Massa apel adalah....

Masih mudah kan? Ayo coba soal berikut untuk meningkatkan kemampuanmu!

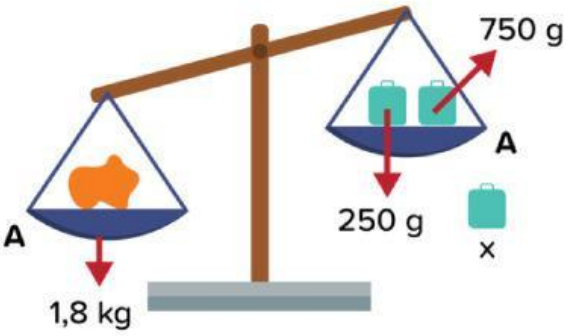

Agar timbang setimbang, maka nilai X adalah....

Agar timbang setimbang, maka nilai balok A adalah....

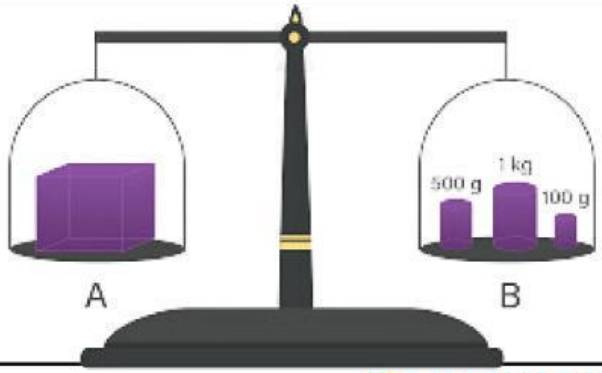

LIVEWORKSHEETS

EXAMPLE

C. Mengukur Massa dengan Neraca Ohaus



Hasil pengukuran neraca ohaus di samping adalah.....

= Ratusan + Puluhan + satuan

= 150 + 20 + 3

= 173 gram

Ayo kita coba soal berikut!

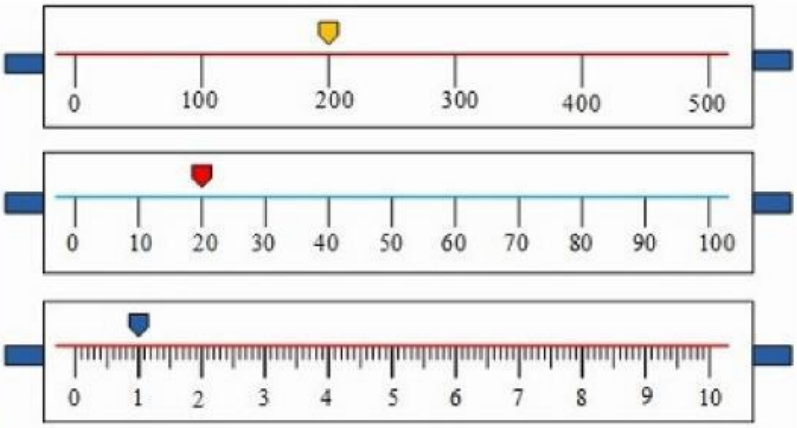

Hasil pengukuran neraca ohaus di samping adalah.....

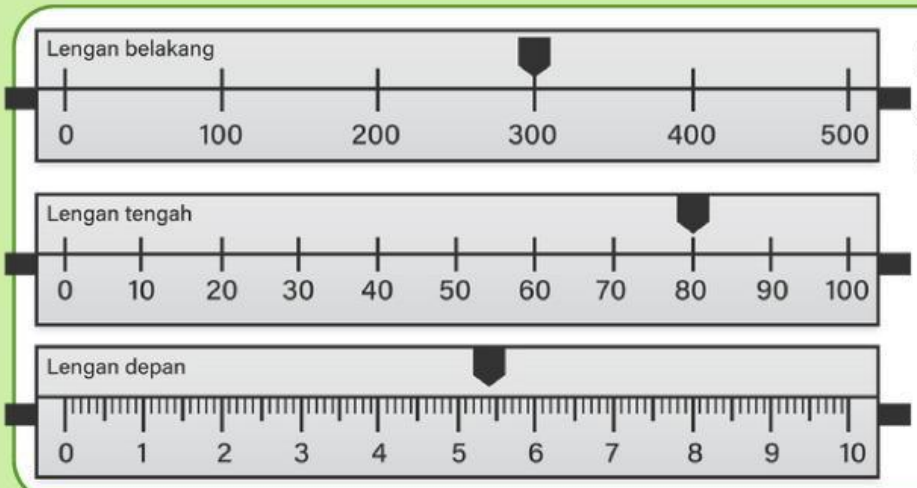

Hasil pengukuran neraca ohaus di samping adalah.....

LIVEWORKSHEETS