INSPIRED TOTS EARLY LEARNING CENTER, JOS
3RD TERM CONTINOUS ASSESSMENT, 2024

NAME: _____

Mathematics ***3RD GRADE***

The table below shows the prices of items in a Fashion Boutique.

ITEMS	PRICES
Skirt	₦3,765.20
Shoe	₦ 2,894.00
Jackets	₦ 5,727.50
Sweaters	₦ 6,080.40

1. What is the price of two pairs of shoes and a jacket?
   ₦_____
2. What is the price of three Skirts and two sweaters?
   ₦_____
3. Which item is the most expensive? _____
4. What is the total price of all the items?
   ₦_____

Mr. Levi has three ₦ 1,000.00 notes and three ₦500.00 notes and wants to buy an oven that costs ₦8,500.00.

5. How much does he have? ₦_____
6. How much does he need to add to get the oven?
   ₦_____

Mrs. Joshua sold 31 pairs of shoes that was bought at the cost of ₦120,000.00 for ₦145,000.00

7. ***Did she make a profit or loss?*** _____
8. ***What is the profit or loss of Mrs. Joshua? ₦***_____
9. ***What is the total loss of selling a set of television that was bought at ₦91,000.00 and sold at ₦80,000.00? ₦***_____
10. ***Solve the followings***

a). $6^2 + 4^2 =$ _____

b). $25^2 - 16^2 =$ _____

11. Find the square root of the following

a). $\sqrt{49}$=_____

LIVEWORKSHEETS

INSPIRED TOTS EARLY LEARNING CENTER, JOS
3RD TERM CONTINOUS ASSESSMENT, 2024

NAME: _____

b) $\sqrt{144}$=_____

12.

Find the perimeter of the following shapes.

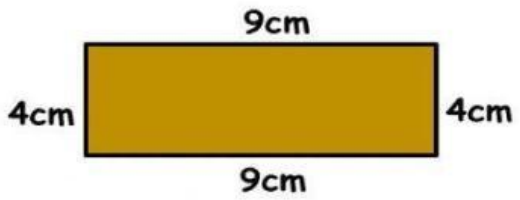

Perimeter =

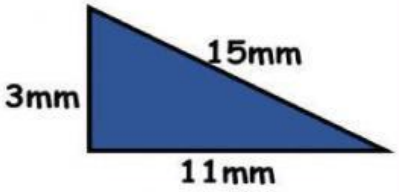

Perimeter =

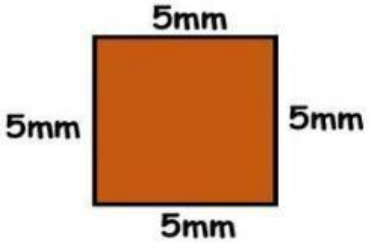

Perimeter =

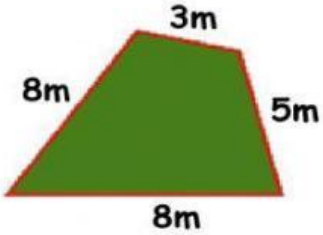

Perimeter =

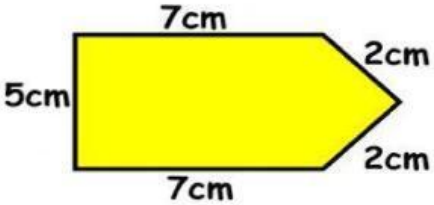

Perimeter =

Perimeter =

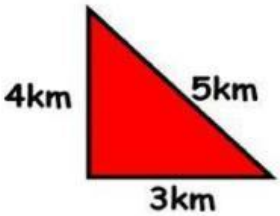

Perimeter =

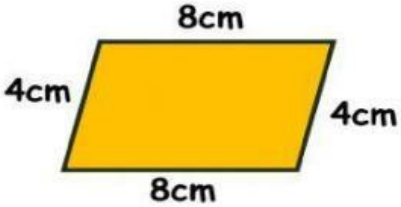

Perimeter =

LIVEWORKSHEETS

INSPIRED TOTS EARLY LEARNING CENTER, JOS
3RD TERM CONTINOUS ASSESSMENT, 2024

NAME: _____

Tick all the perfect squares in each row and column

	1	2	3	4	5	6	7	8	9	10	11	12
1	1	2	3	4	5	6	7	8	9	10	11	12
2	2	4	6	8	10	12	14	16	18	20	22	24
3	3	6	9	12	15	18	21	24	27	30	33	36
4	4	8	12	16	20	24	28	32	36	40	44	48
5	5	10	15	20	25	30	35	40	45	50	55	60
6	6	12	18	24	30	36	42	48	54	60	66	72
7	7	14	21	28	35	42	49	56	63	70	77	84
8	8	16	24	32	40	48	56	64	72	80	88	96
9	9	18	27	36	45	54	63	72	81	90	99	108
10	10	20	30	40	50	60	70	80	90	100	110	120
11	11	22	33	44	55	66	77	88	99	110	121	132
12	12	24	36	48	60	72	84	96	108	120	132	144

LIVEWORKSHEETS