CI RAGIONO...

1 OSSERVA LE ILLUSTRAZIONI, LEGGI, CONTA E COMPLETA.

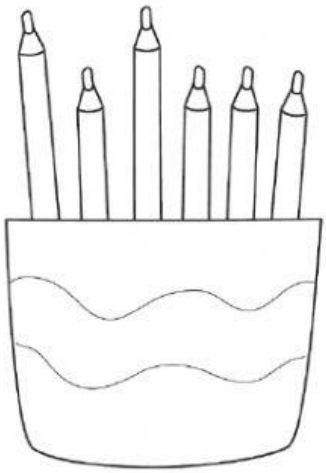

QUANTE MATITE IN TUTTO?

LE MATITE LUNGHE SONO ..... .

LE MATITE CORTE SONO ..... .

☐ + ☐ = ☐

LE MATITE IN TUTTO SONO ..... .



QUANTI ANIMALI IN TUTTO?

LE RANE IN TUTTO SONO ..... .

I PESCI IN TUTTO SONO ..... .

☐ ○ ☐ ○ ☐

GLI ANIMALI IN TUTTO SONO ..... .

LIVEWORKSHEETS

CHE COSA RESTA?

1 Osserva, conta, poi completa.



..... barchette in tutto

..... barchette affondate

..... barchette rimaste

☐ − ☐ = ☐



..... fragole in tutto

..... fragole raccolte

..... fragole rimaste

☐ − ☐ = ☐



..... uova in tutto

..... uova rotte

..... uova rimaste intere

☐ − ☐ = ☐



..... fette in tutto

..... fette sul vassoio

..... fette nella mano di Pino

☐ − ☐ = ☐

LIVEWORKSHEETS