INSPIRED TOTS EARLY LEARNING CENTRE

1ST GRADE THIRD TERM ASSESSMENT

SUBJECT: ARITHMETIC

1. Draw a line to match each coin with its value.

10¢ or $.10

25¢ or $.25

5¢ or $.05

1¢ or $.01

2. Write the cent in dollars. Do not forget your decimal point.

26¢	7¢	34¢	50¢
$_____	$_____	$_____	$_____

LIVEWORKSHEETS

INSPIRED TOTS EARLY LEARNING CENTRE

1ST GRADE THIRD TERM ASSESSMENT

SUBJECT: ARITHMETIC

3. Click on the correct fraction to show the shaded part.



a. $\frac{1}{3}$ **b.** $\frac{1}{2}$ **c.** $\frac{1}{4}$



a. $\frac{1}{4}$ **b.** $\frac{1}{3}$ **c.** $\frac{1}{2}$

4. Click on the correct answer.

1 year= _____days a. 165 days b. 365 days c. 7 days

1 gallon = _____ quarts a. 2 quarts b. 1 quart c. 4 quarts

1 year = _____months a. 12 months b. 52 months c. 24 months

1 yard= _____inches a. 12 inches b. 36 inches c. 3 inches

1 hour = _____ minutes a. 15 minutes b. 30 minutes c. 60 minutes

5. How much money? Remember your decimal point.

= $_____

LIVEWORKSHEETS

INSPIRED TOTS EARLY LEARNING CENTRE

1ST GRADE THIRD TERM ASSESSMENT

SUBJECT: ARITHMETIC

6. Write the following numbers.

_____ _____ _____ _____

7. Write the sums.

5, 2 0 5	5 6 2	8 2
+ 3, 1 0 5	- 3 5 1	- 4 8

8. Write two addition and subtraction sentences.

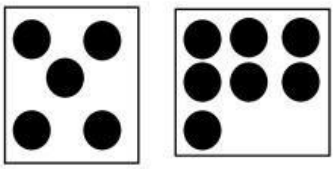

☐ + ☐ = ☐

☐ + ☐ = ☐

☐ - ☐ = ☐

☐ - ☐ = ☐

9. Kristen, a girl from Oslo, collects coins. She received three dimes, two nickels and five pennies from her American friend. Write how much cents she received.

_____¢

LIVEWORKSHEETS

INSPIRED TOTS EARLY LEARNING CENTRE

1ST GRADE THIRD TERM ASSESSMENT

SUBJECT: ARITHMETIC

10. What time does each clock show?

a. 10:04 b. 10:20 c. 4:10

a. 9:12 b. 9:00 c. 11:45



a. 10:15 b. 10:03 c. 3:10

a. 1:05 b. 5:01 c. 1:25

LIVEWORKSHEETS