Name : _____

Identifying & Naming 2D Shapes

Identify each 2D shape and write its name.

1)

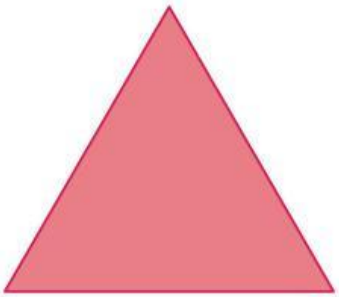

_____

2)



_____

3)

_____

4)

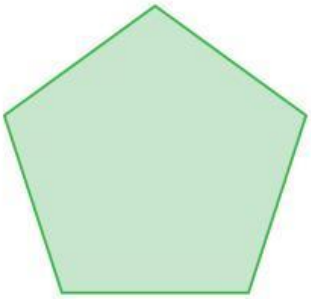

_____

5)

_____

6)

_____

7)



_____

8)



_____

9)



_____

LIVEWORKSHEETS