Math Worksheet

Name:
Class:
Date:

Contoh

Jajargenjang

K = (5 + 3) x 2 = 16 cm

L = 5 x 2 = 10 cm^2

Trapesium

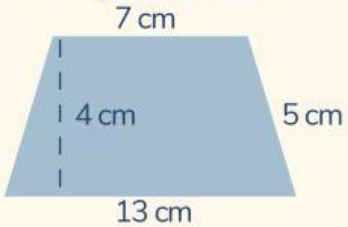

K = 7 + 13 + 5 + 5 = 30 cm

L = $\frac{1}{2}$ x (7 + 13) x 4 = 40 cm^2

Hitunglah luas dan keliling bangun datar di bawah ini!

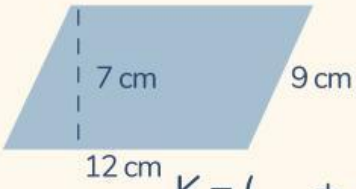

K = (+) x = cm

L = x = cm^2

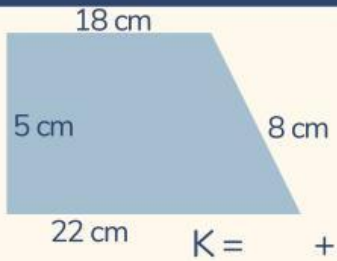

K = + + + = cm

L = $\frac{1}{2}$ x (+) x = cm^2

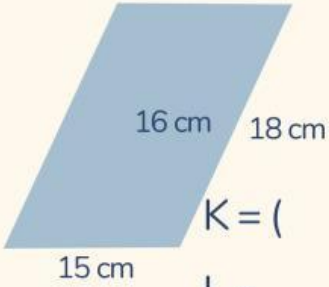

K = (+) x = cm

L = x = cm^2

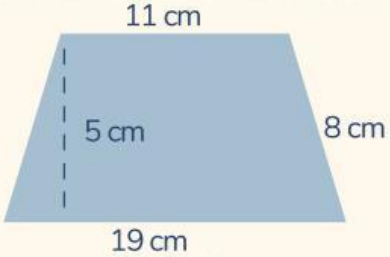

K = + + + = cm

L = $\frac{1}{2}$ x (+) x = cm^2

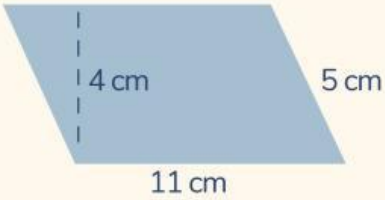

K = (+) x = cm

L = x = cm^2

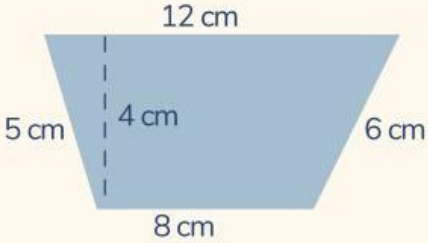

K = + + + = cm

L = $\frac{1}{2}$ x (+) x = cm^2

LIVEWORKSHEETS