Latihan Soal Luas Bangun Datar Kelas 3

Nama :…….

Pasangkanlah gambar yang sesuai dengan luasnya !

1. 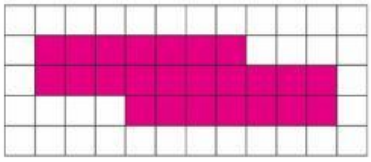

42

2. 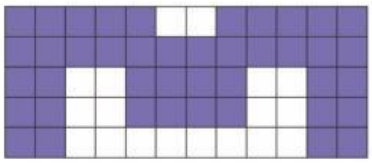

36

3. 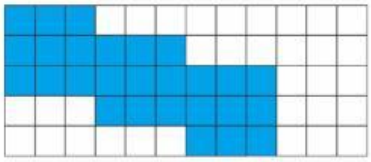

24

4. 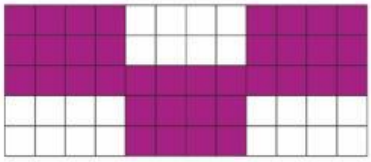

45

5. 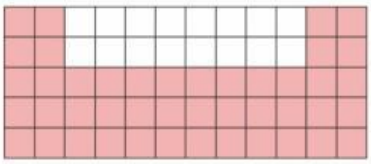

27

6. 

44

7. 

40

LIVEWORKSHEETS