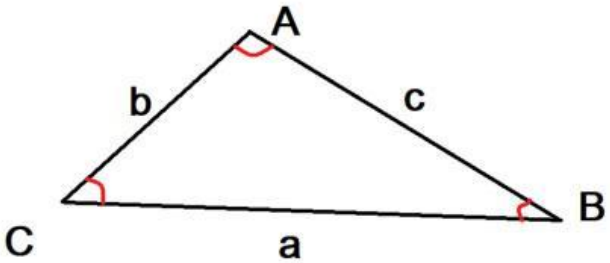

A triangle whose sides b and c are 45 cm and 66 cm respectively and whose angle α is 47°. Find how much side a is and Angles B and C.

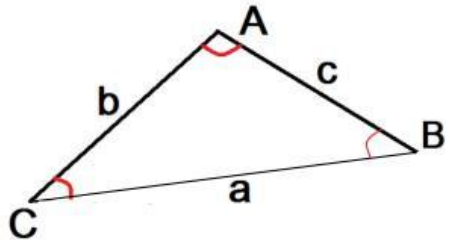

The angle C is 38º and the sides a and b are 17 and 22 respectively. Find side c, angles B and C.

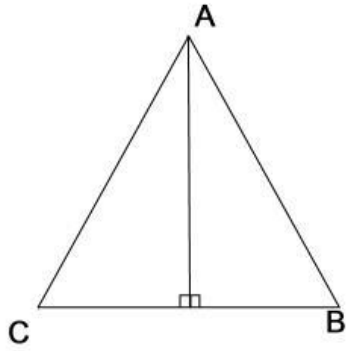

In this triangle is given only the height, which is 24 and C which is 60º. Calculate
b, c, a and angles A and B. You can use either Trigonometry and Phytagoras.

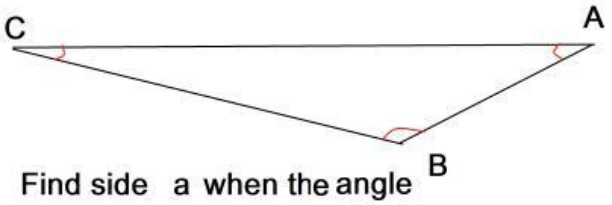

Find side a when the angle A is 63º b is 23 and c is 12

LIVEWORKSHEETS