ชื่อ.....ชั้น.....เลขที่.....

แบบฝึกหัด เรื่อง กรด เบส

1.จงเติมตารางต่อไปนี้ให้สมบูรณ์

สาร	กรด เบส กลาง
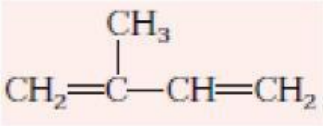	
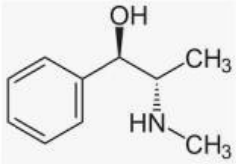	
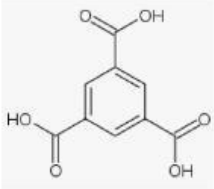	
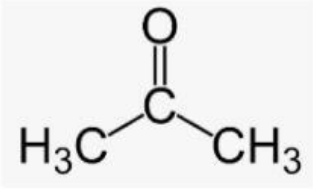	
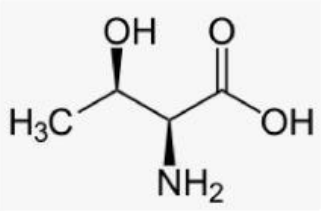	
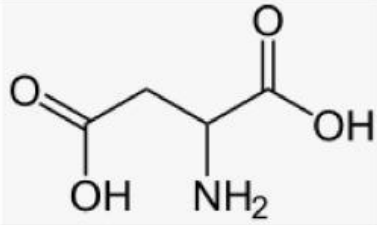	

LIVEWORKSHEETS

LIVEWORKSHEETS