MATEMÀTIQUES

Completa les capsetes multiplicatives següents:

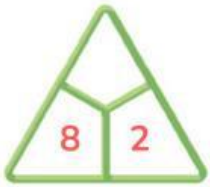

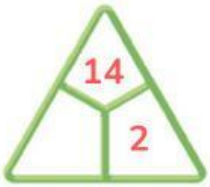

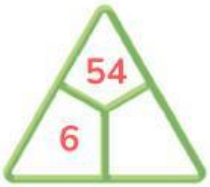

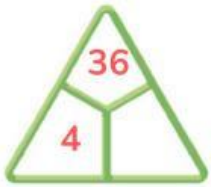

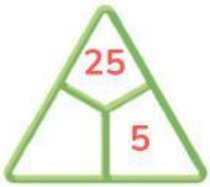

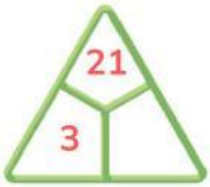

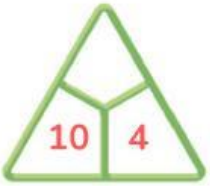

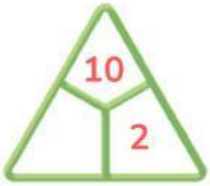

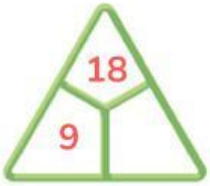

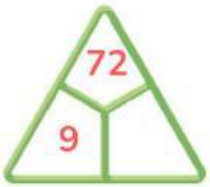

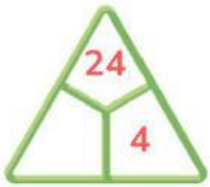

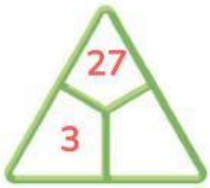

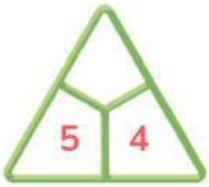

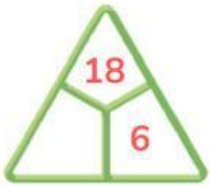

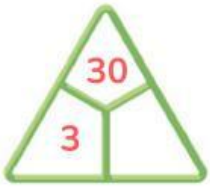

LIVEWORKSHEETS

Resol pas a pas les següents multiplicacions de dues xifres. Observa l'exemple per recordar com ho fem a classe.

24 x 6 = 144

	20	4
6	120	24

$$\begin{array}{r} 120 \\ +\ \ 24 \\ \hline 144 \end{array}$$

42 x 3 = ____

	40	2
3		

$$\begin{array}{r} _____ \\ +\ ____ \\ \hline _____ \end{array}$$

16 x 2 = ____

	10	6
2		

$$\begin{array}{r} _____ \\ +\ ____ \\ \hline _____ \end{array}$$

35 x 6 = ____

$$\begin{array}{r} _____ \\ +\ ____ \\ \hline _____ \end{array}$$

No recordes com feiem les multiplicacions de dues xifres? Mira aquest vídeo!

LIVEWORKSHEETS