Kurikulum Merdeka

# Lembar Kerja Peserta Didik

## Bangun Ruang Matematika

Dina Aulia Larasati

K7122090 / 33

Untuk kelas :

**5 SD Semester 1**

LIVEWORKSHEETS

Nama : _____ Kelas : _____

# Bangun Ruang

Hitunglah banyak rusuk, sisi, dan titik sudut bangun ruang berikut!

1.

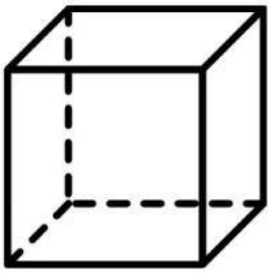

Banyak Sisi : .....

Banyak Rusuk : .....

Banyak Titik Sudut : .....

2.

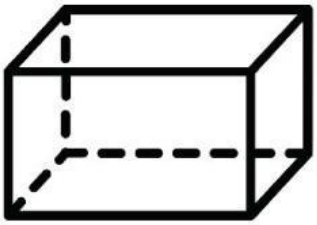

Banyak Sisi : .....

Banyak Rusuk : .....

Banyak Titik Sudut : .....

3.

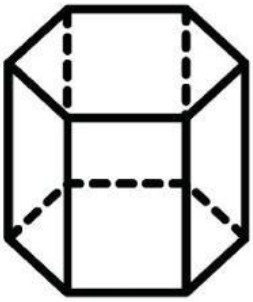

Banyak Sisi : .....

Banyak Rusuk : .....

Banyak Titik Sudut : .....

4.



Banyak Sisi : .....

Banyak Rusuk : .....

Banyak Titik Sudut : .....

5.



Banyak Sisi : .....

Banyak Rusuk : .....

Banyak Titik Sudut : .....

LIVEWORKSHEETS

Nama : .....

Kelas : .....

# Bangun Ruang

Pasangkan nama bangun yang sesuai dengan gambar yang diberikan.

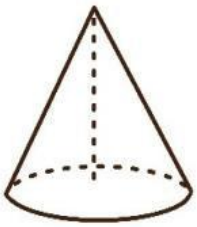

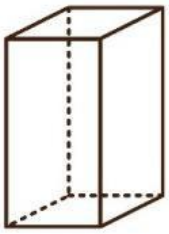

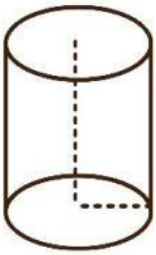

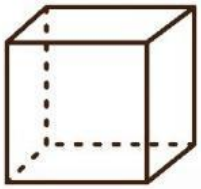

- Kerucut
- Bola
- Kubus
- Balok
- Tabung

LIVEWORKSHEETS