Taller ésteres, aminas y amidas

1. **De los siguientes compuestos químicos reconocer a que función química corresponden:**

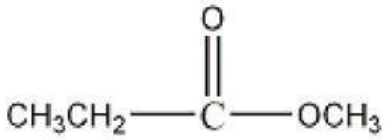	
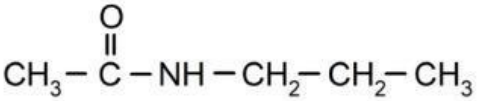	
Etilamina	
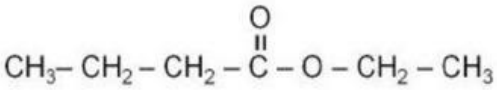	
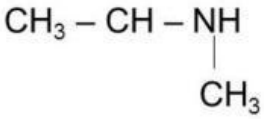	
Etanoato de metilo	
Butanamida	

2. **Una mediante una línea según corresponda los tipos de aminas**

a)

b) 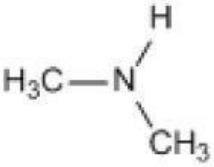

c) 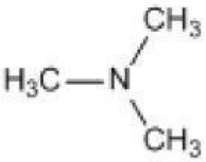

LIVEWORKSHEETS