A

Is the rectangle partitioned equally?

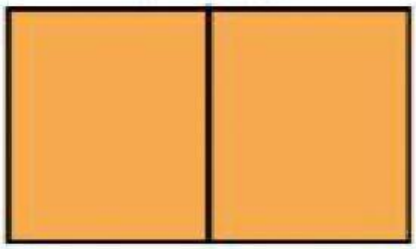

©Meredith Bilbert 2016
Sunshine, Sand and Scissors

B

Is the circle partitioned equally?



©Meredith Bilbert 2016
Sunshine, Sand and Scissors

C

How is the rectangle partitioned?

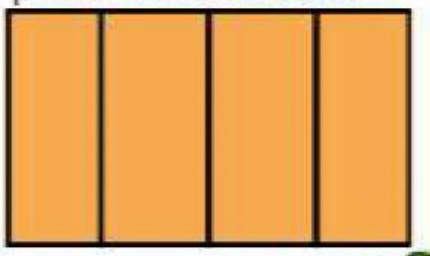

©Meredith Bilbert 2016
Sunshine, Sand and Scissors

D

How is the circle partitioned?



©Meredith Bilbert 2016
Sunshine, Sand and Scissors

LIVEWORKSHEETS