2. What is Long? What is Round?

Worksheet - 2

Subject: Maths

Class: I

Name:

Date :

Tick (✔) the objects that are round:

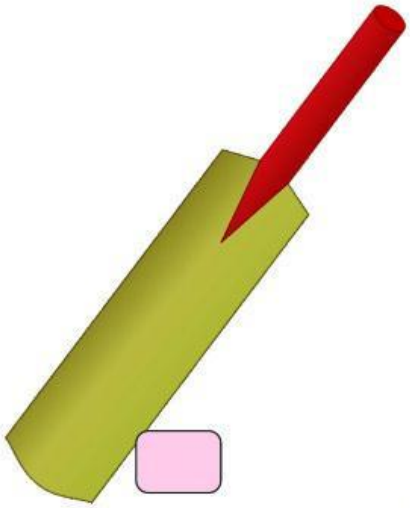





STC

LIVEWORKSHEETS