1)

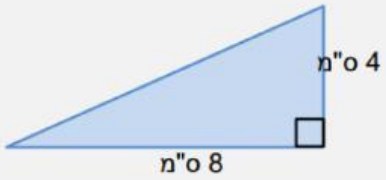

שטח = _____ ס"מ רבוע (ס"מ2)

2)

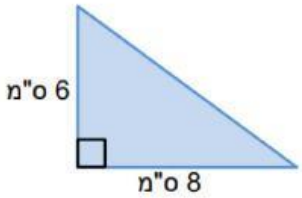

שטח = _____ ס"מ רבוע (ס"מ2)

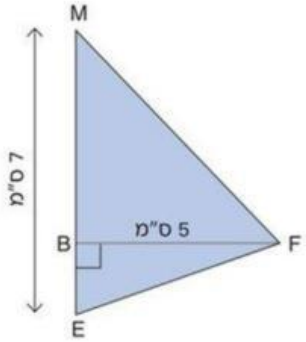

שטח = _____ ס"מ בריבוע

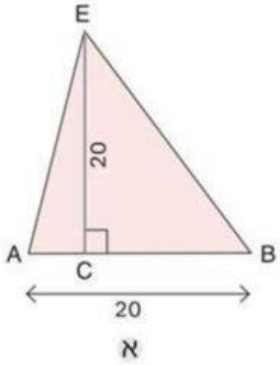

שטח = _____ ס"מ בריבוע

LIVEWORKSHEETS