D Count and circle the correct answer. TP2

1

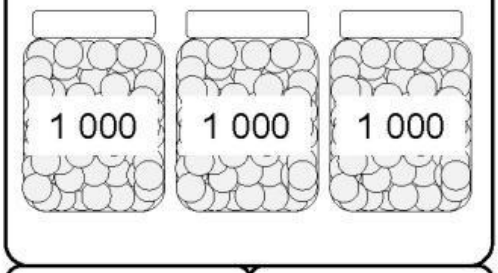

3 000 | 2 000

2

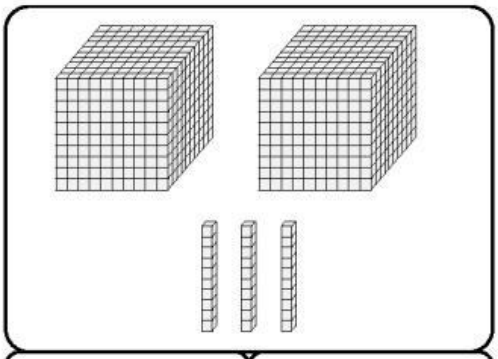

2 300 | 2 030

3

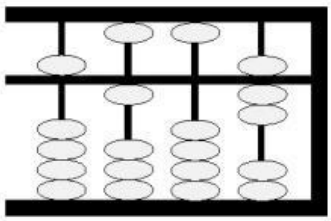

5 103 | 5 107

4

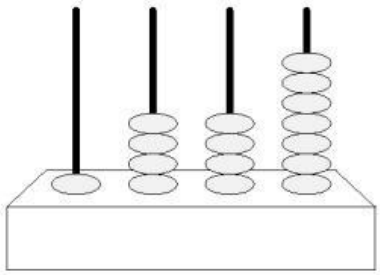

1 447 | 1 446

E State the digit value and the place value of the underlined digit. TP3

	Number	Digit value	Place value
1	3 3<u>2</u>7		
2	7 <u>5</u>14		
3	<u>9</u> 470		

F Complete the following extended notation. TP3

1 4 610 ▷ 4 thousands + _____ + 1 tens + _____

2 6 725 ▷ _____ + 700 + _____ + 5

3 9 011 ▷ _____ + _____ + _____ + 1 ones

LIVEWORKSHEETS