Kurikulum Merdeka

LKPD

KEKONGRUENAN DAN KESEBANGUNAN

Nama :

No Absen :

LIVEWORKSHEETS

KEGIATAN 1

Carilah pasangan bangun yang kongruen dan letakkan gambar dikotak yang disediakan







LIVEWORKSHEETS

KEGIATAN 2

Hubungkan dengan garis pasangan bangun datar dibawah ini yang kongruen

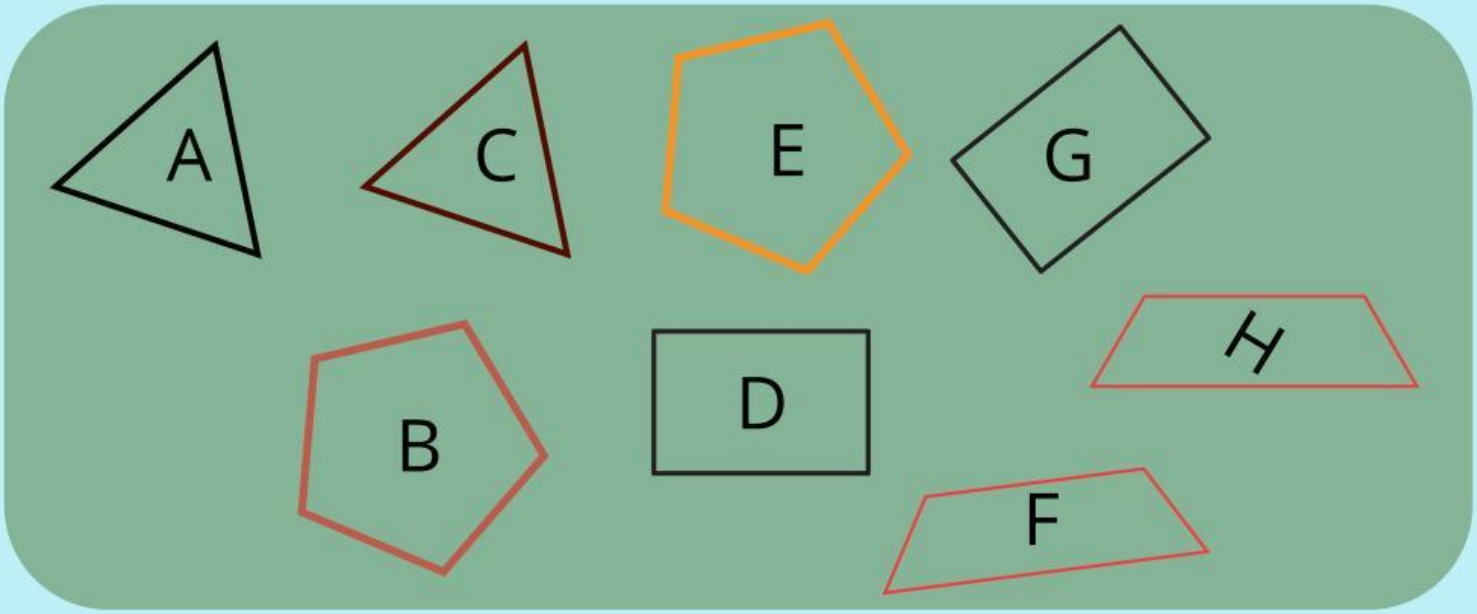

LIVEWORKSHEETS

KEGIATAN 3

Trapesium ABCD kongruen dengan trapesium EFGH. Tentukan pasangan sudut yang bersesuaian!

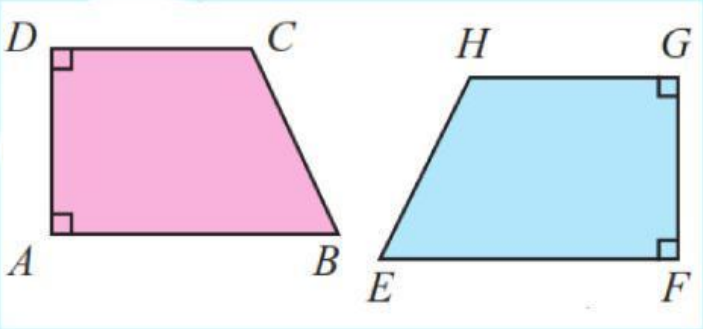

Sudut A = Sudut.....

Sudut B = Sudut.....

Sudut C = Sudut.....

Sudut D = Sudut.....

Perhatikan gambar dibawah!
Trapesium ABCD kongruen dengan trapesium PQRS. Tentukan panjang AD, DC, QR, dan, QP!

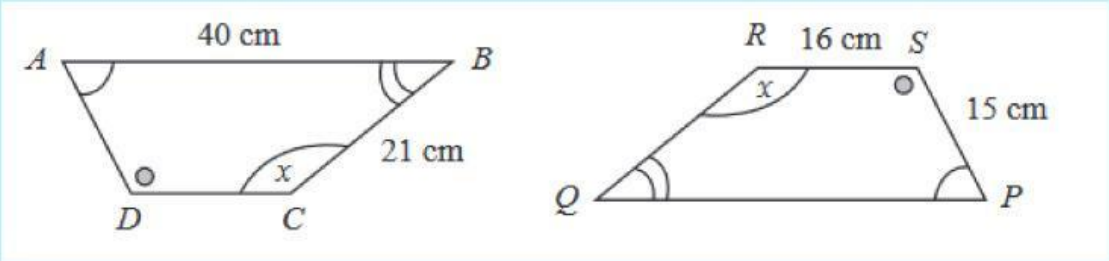

Panjang AD = Panjang ... = ... cm

Panjang QR = Panjang ... = ... cm

Panjang DC = Panjang ... = ... cm

Panjang QP = Panjang ... = ... cm

LIVEWORKSHEETS