2. Điền các câu lệnh, số đúng vào chỗ chấm để vẽ các hình theo mẫu.

Dòng lệnh 1	Dòng lệnh 2	Dòng lệnh 3	Kết quả
FD 50 RT 120 FD 50 RT 120 ……..	REPEAT 3[FD 50 RT 120]	REPEAT 3[FD 50 RT 360/…..]	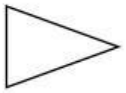
FD 50 RT 90 …….. …….. ……..	REPEAT 4[FD 50 RT ……]	REPEAT 4[FD 50 RT 360/……]	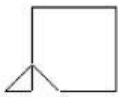
FD 50 RT 72 …….. …….. …….. ……..	REPEAT…..[FD 50 RT…..]	REPEAT 5[FD 50 RT ……/5]	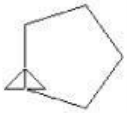
FD 50 RT 60 …….. …….. …….. …….. ……..	REPEAT…..[FD 50 RT…..]	REPEAT ..…[FD 50 RT ……/6]	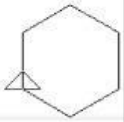

LIVEWORKSHEETS