Infants B

Mathematics Mid-Term Test

February 23rd, 2020

Name: _____

Type these numbers in words.

Example: 10 <u>ten</u>

a) 2 _____

b) 6 _____

(__/2)

LIVEWORKSHEETS

Type these number names in figures.

Example: eleven 11

c) four _____

d) five _____

(___/2)

e) Match the following shapes to their names.



sphere

circle

cube

(___/3)

LIVEWORKSHEETS

f) What is the time? Drag the correct boxes to the clocks.

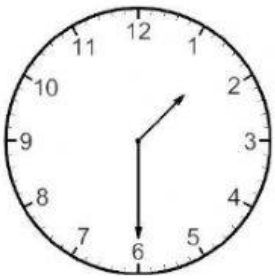



3 o'clock

12 o'clock

half past 1

(____/3)

g) Click the right answer.

I am longer.



(____/1)

LIVEWORKSHEETS

h) Click the correct answer. Which one holds less?

(___/1)

i) Click on all the shapes that have one half (1/2) coloured.



(___/2)

LIVEWORKSHEETS

Calculate the following.

Add

j) 5 + 2 =

k) 3

\- 1

_____

_____

(____/2)

LIVEWORKSHEETS