Teorema ángulo inscrito.

Todo ángulo inscrito en una circunferencia tiene como medida la mitad del ángulo del centro que sintiendo el mismo arco.

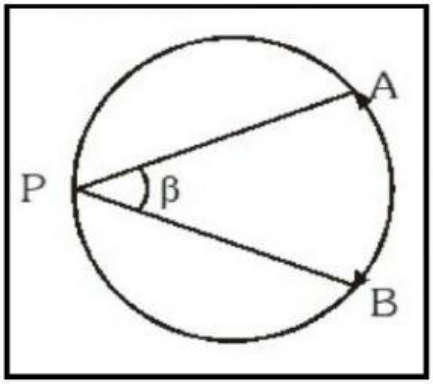

B= MAB %2

Práctica con estos ejercicios.

i) Hallar el valor de X

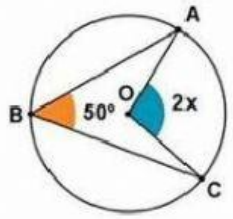

m) Hallar el valor de α

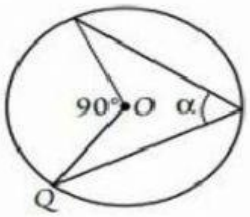

LIVEWORKSHEETS

j) Hallar el valor de B

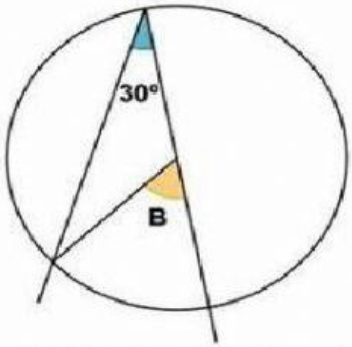

k) Hallar el valor de $\alpha + \beta$

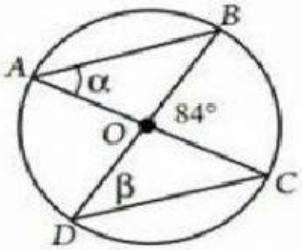

l) Hallar el valor de α

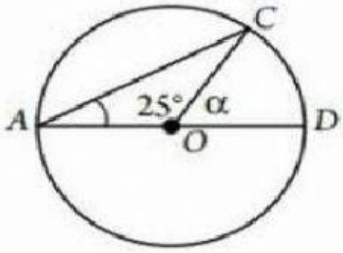

n) Hallar el valor de α

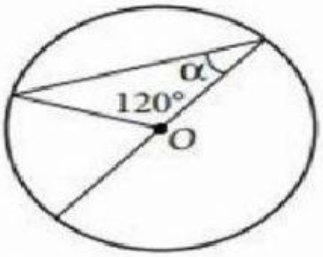

o) ñ) Hallar el valor de α

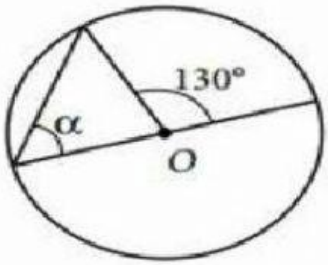

p) Hallar el valor de β

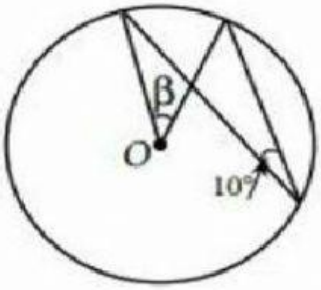

LIVEWORKSHEETS