INSPIRED TOTS EARLY LEARNING CENTRE
K4 SECOND TERM EXAMINATION,2024

NUMERACY

Complete the missing numbers.

101			104	105		107			110
	92		94	95			98		
81		83			86			89	90
	72		74	75		77		79	
61			64		66			69	
	52	53		55			58		60
41			44	45		47		49	

Write the numbers that come before and after the number in the middle

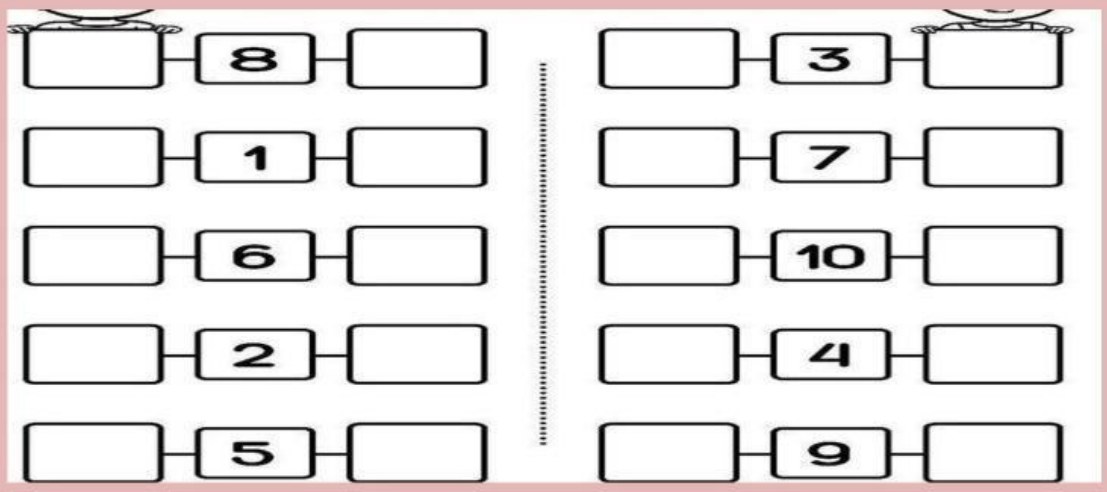

LIVEWORKSHEETS

INSPIRED TOTS EARLY LEARNING CENTRE
K4 SECOND TERM EXAMINATION,2024

Choose the set that has less



Drag and drop to arrange the numbers from biggest to smallest

10	8	4	2	6

Count the objects. Select the correct number

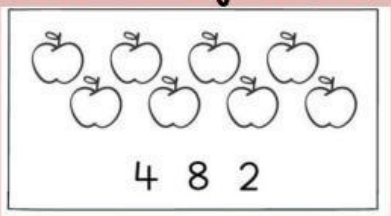

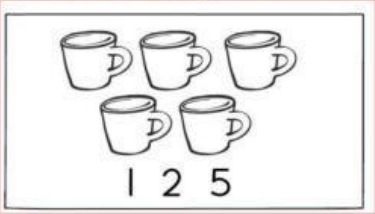

Add and write the answers

	

LIVEWORKSHEETS

INSPIRED TOTS EARLY LEARNING CENTRE
K4 SECOND TERM EXAMINATION,2024

Count and subtract

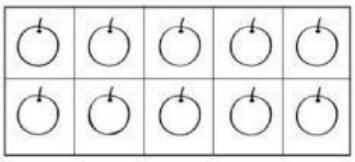

10 - 5 = ☐

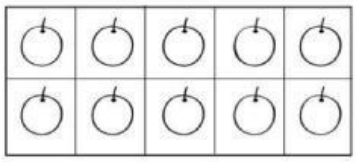

10 - 3 = ☐

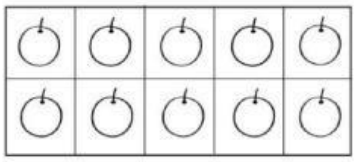

10 - 2 = ☐

Match the numbers to the word form.

	one two	
	three four	
	five six	
	seven eight	
	nine ten	

LIVEWORKSHEETS

INSPIRED TOTS EARLY LEARNING CENTRE
K4 SECOND TERM EXAMINATION,2024

Story problems on addition and subtraction.

Martin plucked 4 apples. Later he plucked 5 more. How many apples did he pluck in total?

____ + ____ = ____

I have 10 apples, I ate 3. How many apples are left? _____

There are 12 oranges. 5 are bad. How many oranges are good? _____

Choose the smallest number.

10 5 7 9 4

5 10 15 12 1

Choose the biggest number.

5 12 2 13 11

8 4 1 2 7

LIVEWORKSHEETS