KINGDOM OF BAHRAIN
Ministry of Education
Al-Jaberiya Sec. Tech. School

مملكة البحرين
وزارة التربية والتعليم
مدرسة الجابرية الثانوية الصناعية

قسم الكهرباء - دعم فئات الطلاب انشطة متمايزة –مقرر ماك803

اسم الطالب:-	الرقم الاكاديمي:-	شعبة: 4كهر3

In the table shown, match the picture with the appropriate words shown?

No	Words	Picture
1-	Step-up Transformer	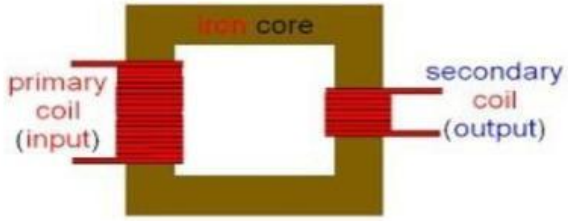
2-	Step-down Transformer	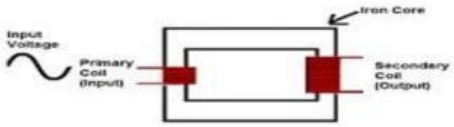
3-	Autotransformer	
4-	Core type Transformer	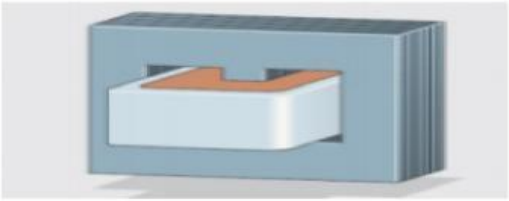
5-	Shell type Transformer	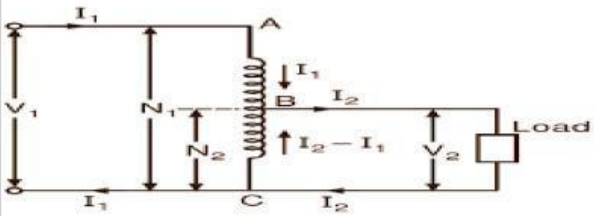

Teacher: AHMED SHAHIN HEAD OF SECTION: REDHA HADI

HEAD MASTER: SAYED REDA

LIVEWORKSHEETS