Name: _____

Mathematics

Revision

| No. | Item (Each item is worth one mark) |
|---|---|
| 1. | Colour 12 ice-creams. |
| 2. | Write the number and number name.  Number:_____ Number name: _____ |
| 3. | Put an (◯) circle around the largest number in each set. a) 12 1 0 9 b) 13 10 5 8 |
| 4. | Colour the image with **4 (four)** objects in the set.  |
| 5. | I am 19 is after me. 20 ☐ 21 ☐ |
| 6. | The number *after* 20 is ◯ |

LIVEWORKSHEETS

| | |
|---|---|
| 7. | Write the **number** and **number name.**<br> <br>**Number:** _____<br>**Number name:** _____ |
| 8. | Fill in the missing numerals.<br> <br> |
| 9. | Write in the missing numbers.<br> 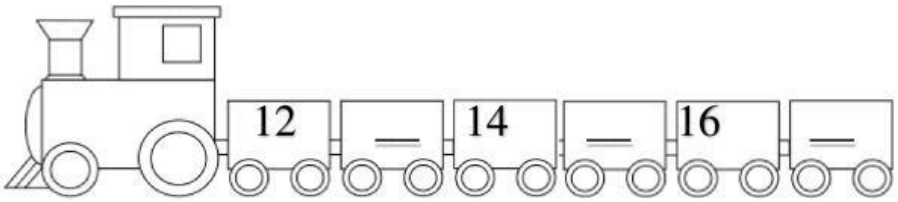 <br> |
| 10. | Skip count by 10's.<br> <br> |
| | **Item (Each item is worth two or three marks)** |
| 11. | Add the dominoes to find the answer. Write the number sentence. (2 marks)<br> 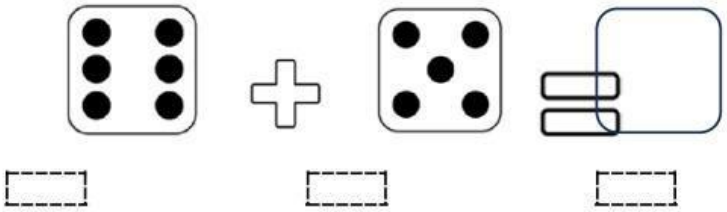 |
| 12. | Draw a line to match the shape to its name. (2 marks)<br> <br>o Cone \| o Sphere \| o Cylinder \| o Cuboid |



LIVEWORKSHEETS

13. Put a tick (✓)to the correct answer. (3 marks)

| | | | | | | |
|---|---|---|---|---|---|---|
| a) A circle is: | | Pointed | | A flat shape | | A solid |
| | | | | | | |
| b) Which shape has 3 sides? | | Rectangle | | Triangle | | Circle |
| | | | | | | |
| c) Which solid can be rolled only? | | Cylinder | | Square | | Cube |

14. Choose (3 marks)

a) The tallest

b) The shortest

c) The lightest

15. Fill in the missing numerals. (2 marks)




16. How many in each set? (2 marks)
Write the number in the ☐

add

equals ☐



LIVEWORKSHEETS

| | |
|---|---|
| 17. | Solve: (3 marks)<br> 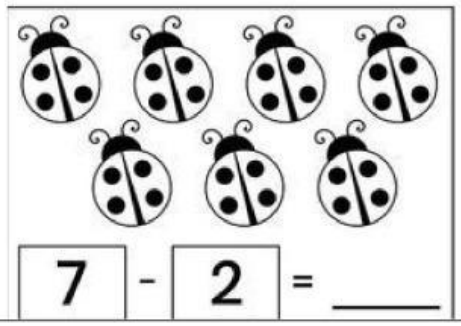 <br>7 - 2 = ____ |
| 18. | Solve: (2 marks)<br>  <br>10 – 2 = __ |
| 19. | Draw lines to match me with my number name. (3 marks)<br>20 o Fourteen<br>14 o Sixteen<br>11 o Twenty<br>16 o Fifteen<br>12 o Eleven<br>15 o Twelve |
| 20. | Tick (✓) the correct response for each of the following. (2 marks)<br>a) heavy ☐ light ☐<br>b) empty ☐ full ☐ |



LIVEWORKSHEETS

LIVEWORKSHEETS