Name : _____

Perimeter of a Square

T1L1S1

Find the perimeter of each square.

1)



Perimeter = ( )

2)



Perimeter = ( )

3)



Perimeter = ( )

4)

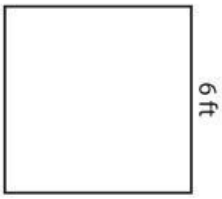

Perimeter = ( )

5)

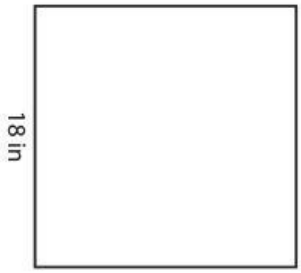

Perimeter = ( )

6)



Perimeter = ( )

7)



Perimeter = ( )

8)



Perimeter = ( )

9)

Perimeter = ( )

LIVEWORKSHEETS