APAE

NOME: _____

ESCOLA: _____ TURMA: _____

PROFESSOR: _____ DATA: ____/____/___

FORMAS GEOMÉTRICAS

1. ESCREVA O NOME DAS FORMAS QUE CADA UM DOS OBJETOS ABAIXO LEMBRAM:

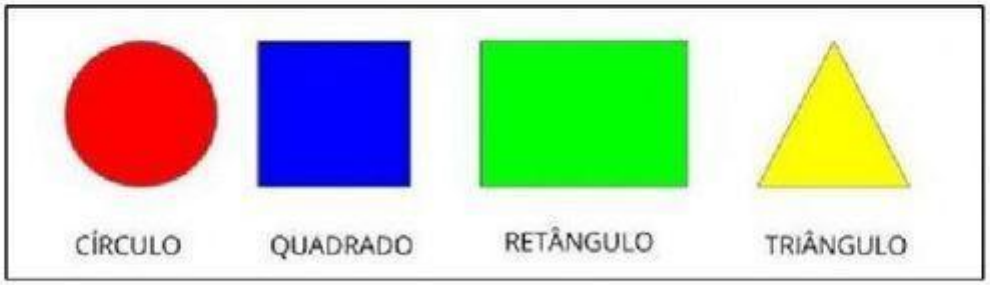





LIVEWORKSHEETS