INDIVIDU

TUGAS 2

Petunjuk

- **Baca doa sebelum mengerjakan**
- **Baca perintah pada soal**
- **Jawablah pada kotak yang telah disediakan**
- **Teliti sebelum submit tugas**

Good Luck!

Identitas

Nama :

No absen :

Pada masing-masing diagram pencar di bawah ini, berikan keterangan (i) jenis korelasinya berdasarkan arah tren data, (ii) bentuk tren datanya dan (iii) interpretasi datanya.

a.

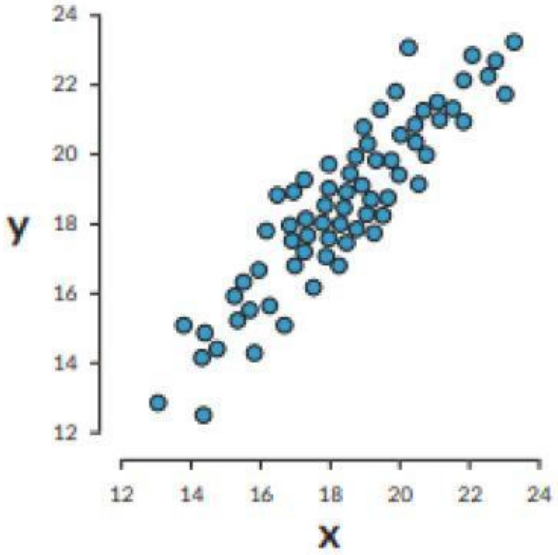

Jenis korelasi (arah tren)

Jenis korelasi (bentuk tren)

Interpretasi data

LIVEWORKSHEETS

b.

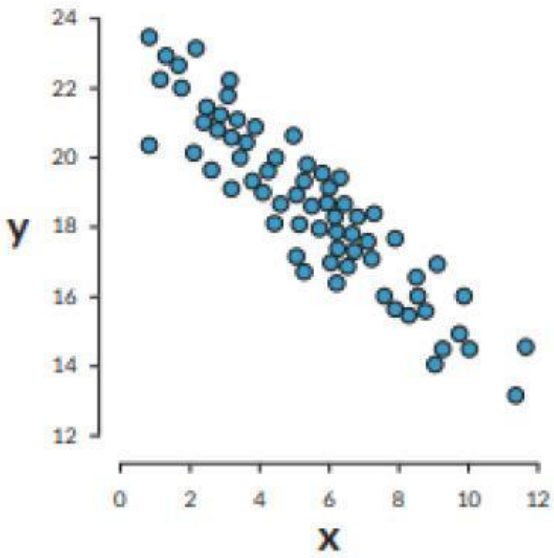

Jenis korelasi (arah tren)

[redacted]

Jenis korelasi (bentuk tren)

[redacted]

Interpretasi data

[redacted]

c.

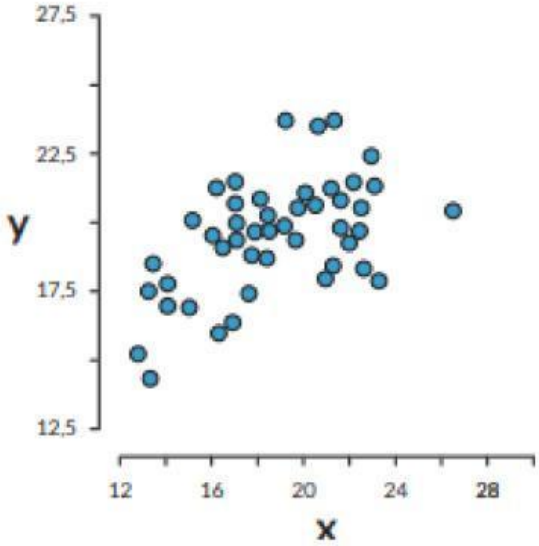

Jenis korelasi (arah tren)

[redacted]

Jenis korelasi (bentuk tren)

[redacted]

Interpretasi data

[redacted]

d.

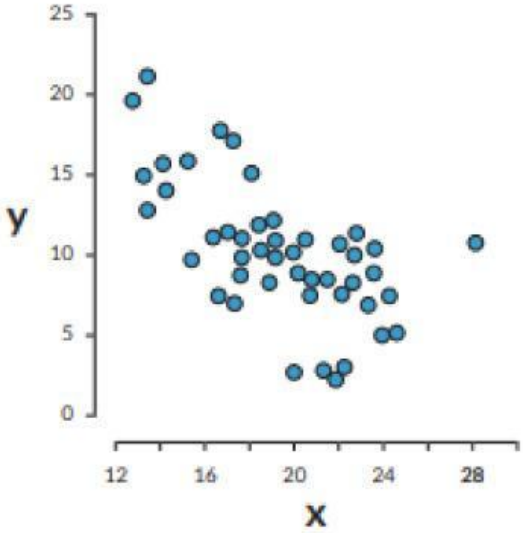

Jenis korelasi (arah tren)

[redacted]

Jenis korelasi (bentuk tren)

[redacted]

Interpretasi data

[redacted]

LIVEWORKSHEETS

e.

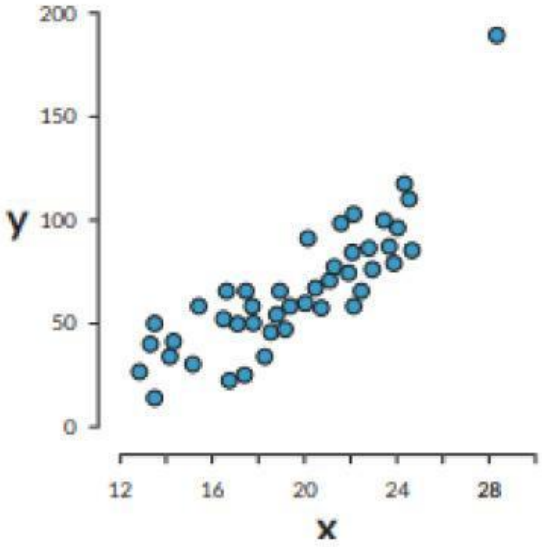

Jenis korelasi (arah tren)

[redacted]

Jenis korelasi (bentuk tren)

[redacted]

Interpretasi data

[redacted]

f.

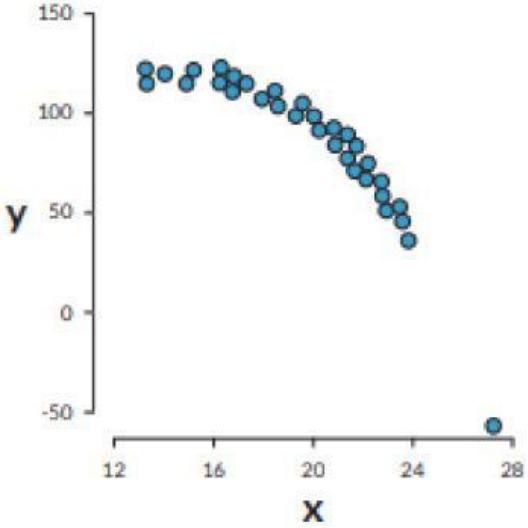

Jenis korelasi (arah tren)

[redacted]

Jenis korelasi (bentuk tren)

[redacted]

Interpretasi data

[redacted]

g.

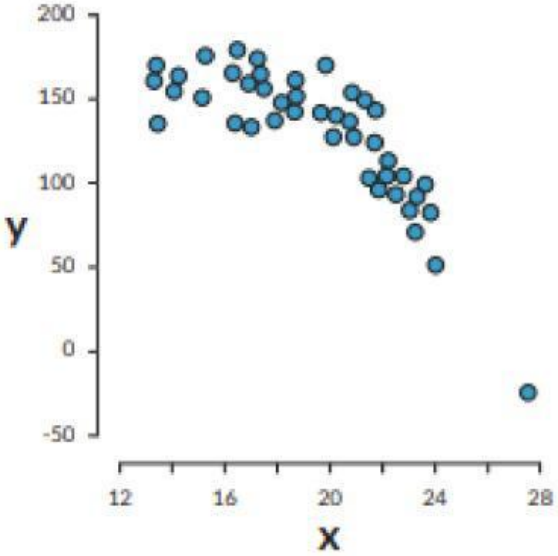

Jenis korelasi (arah tren)

[redacted]

Jenis korelasi (bentuk tren)

[redacted]

Interpretasi data

[redacted]

LIVEWORKSHEETS