FICHA INTERACTIVA

1.Escribe el compás que corresponde a cada fragmento.



2. Indica si los siguientes intervalos son armónicos o melódicos:





3. Escribe el nombre de las siguientes notas en clave de fa en 4ª:



4. Clasifica los siguientes intervalos e indica tonos y semitonos :





LIVEWORKSHEETS