ÁNGULOS Y POLIGONOS

1. Relaciona cada polígono con su nombre:



TRIÁNGULO

PENTÁGONO

HEXÁGONO

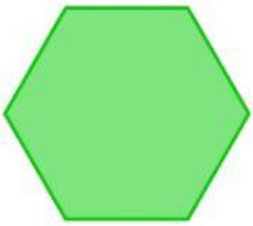

CUADRADO

LIVEWORKSHEETS

2. Relaciona cada ángulo con su nombre.



OBTUSO



AGUDO



RECTO

3. ¿Cuál es el perímetro de un triángulo de 5 cm de lado?

Perímetro = + + = cm

LIVEWORKSHEETS