2D Shapes

Name the shape, and write the number of sides:



_____ _____



_____ _____

_____ _____

_____ _____



_____ _____



_____ _____

LIVEWORKSHEETS

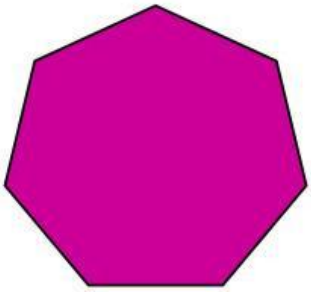





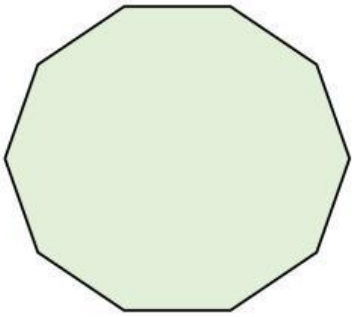

LIVEWORKSHEETS