2) *Ángulo Inscrito*

Todo ángulo inscrito en una circunferencia tiene como medida la mitad del ángulo del centro que subtiende el mismo arco.

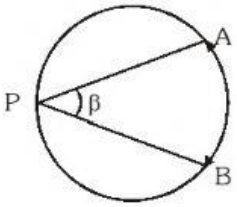

$$\beta = \frac{m\overset{\frown}{AB}}{2}$$

Del gráfico, calcular θ.

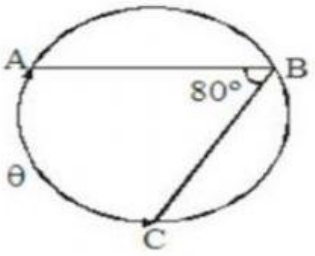

) Hallar el valor de X

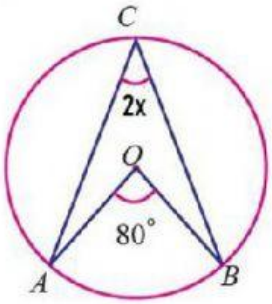

Del gráfico, calcular ψ.

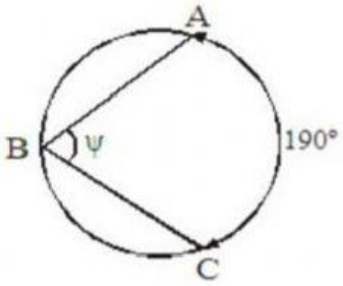

Hallar el valor de X

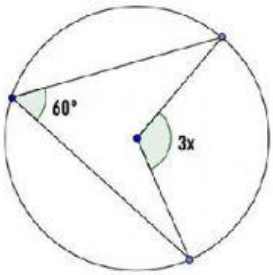

LIVEWORKSHEETS