Nome: _____ Data: ___/____/____

Completa as tabelas conforme os exemplos.

+	5	6	7	8	9
5	10				
6					
7					
8					
9					

−	5	6	7	8	9
5	0				
6					
7					
8					
9					

Resolve mentalmente e completa os muros numéricos. Observa o exemplo.



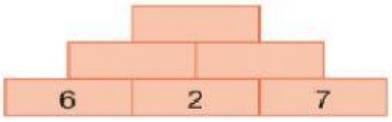



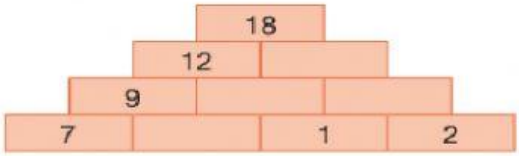

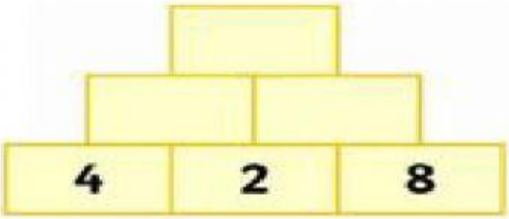

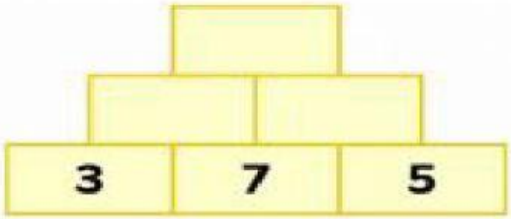

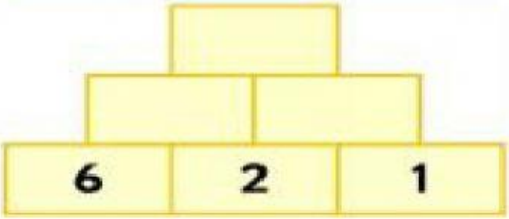

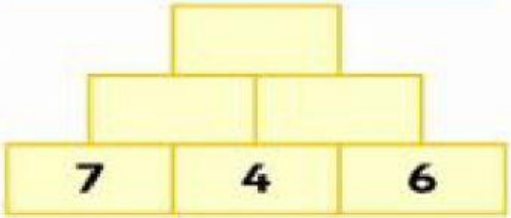

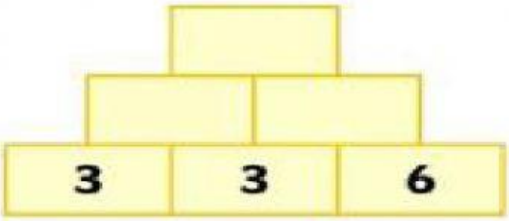

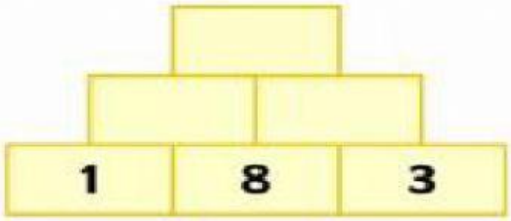

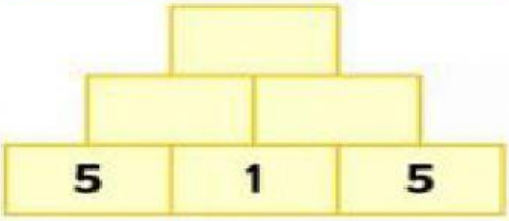

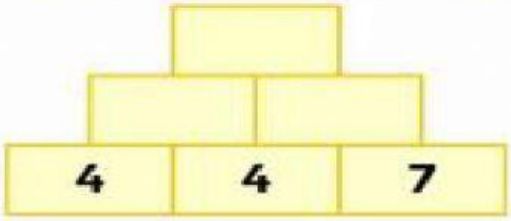

LIVEWORKSHEETS

Quais palavras tornam esta declaração verdadeira?

16 _____ 16.

é maior que	é menor que	é igual a

Qual sinal torna a declaração verdadeira?

20 ? 19

>	<	=

Use as formas para continuar com o padrão de ABC.

Use as formas para formar um padrão de AB.



LIVEWORKSHEETS