ADUNAREA CU 1-5 UNITĂȚI

I.1. Scrie în căsuțe A (adevărat) pentru rezultatul corect și F (fals) pentru rezultatul incorect.

2 + 3 = 5

4 + 4 = 7

6 + 2 = 8

I.2. Unește imaginea cu operația potrivită:







3 + 4 = 7
5 + 4 = 9
2 + 2 = 4
3 + 5 = 8

I.3. Colorează caseta cu răspunsul corect :



				3
4	+	2	=	6
				5



				10
5	+	5	=	9
				8



						5
4	+	1	+	3	=	8
						7

I.4. Calculează punctele de pe piesele de domino și scrie rezultatul:



6	+	3	=	

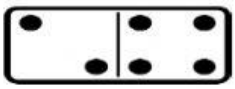

2	+	4	=	



2	+	2	+	5	=	

I.5. Mia, Maria și Nițu au puișori. Calculează câți puișori au copiii?



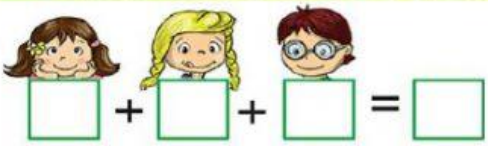

LIVEWORKSHEETS

I.6. Veverița Rița a strâns alune pentru iarnă. Luni a strâns 4 alune, iar marți a strâns 5 alune. Câte alune are acum Rița?



Are acum ☐

I.7. Compune o problemă după imaginea:

☐ + ☐ = ☐

R: ☐

LIVEWORKSHEETS