# LKPD
# MATEMATIKA

Nama :

Kelas :

LIVEWORKSHEETS

# PERKALIAN

Pasangkan gambar dengan kalimat matematika yang tepat



4 x 2

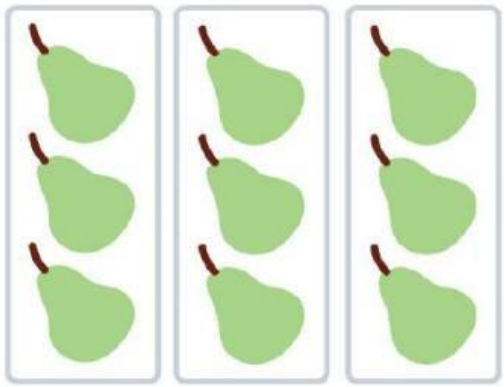

2 x 3



3 x 3

LIVEWORKSHEETS

# Nama Bilangan

Tuliskan nama bilangan sesuai angka

| | | |
|---|---|---|
| 2 | 4 | 7 |
| | | |

Pilihlah salah satu jawaban dengan memberi tanda centang jawaban paling tepat

1. "Dua puluh lima" memiliki simbol....

   - 20
   - 30
   - 25
   - 35

2. Tentukan simbol dari "empat ratus lima".....

   - 400
   - 405
   - 450
   - 45

*Selamat Mengerjakan*

LIVEWORKSHEETS