KENDRRIYA VIDYALAYA KHANDWA WORKSHEET 2020-21

Class- 3 Sub-Mathematics

Chapter- Revision Subject Teacher- Vipul Yadav.

1-

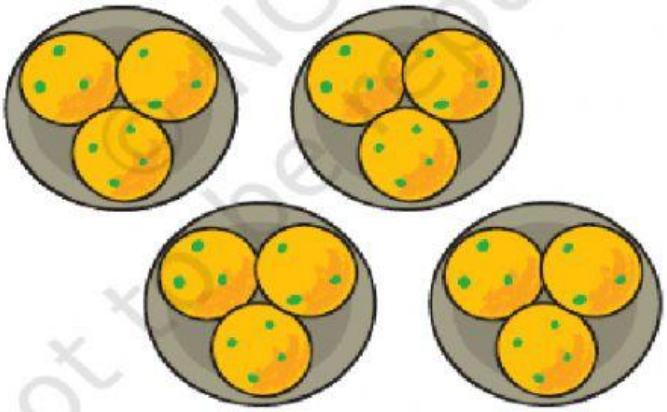

- There are _____ laddoos.

  They are in _____ groups.

  There are _____ laddoos in each group.

2. Share 25 bananas among 5 monkeys. How many bananas for each monkey?



_____ ÷ 5 = _____

Each monkey has _____ bananas.

LIVEWORKSHEETS

3-

Jumpy Animals

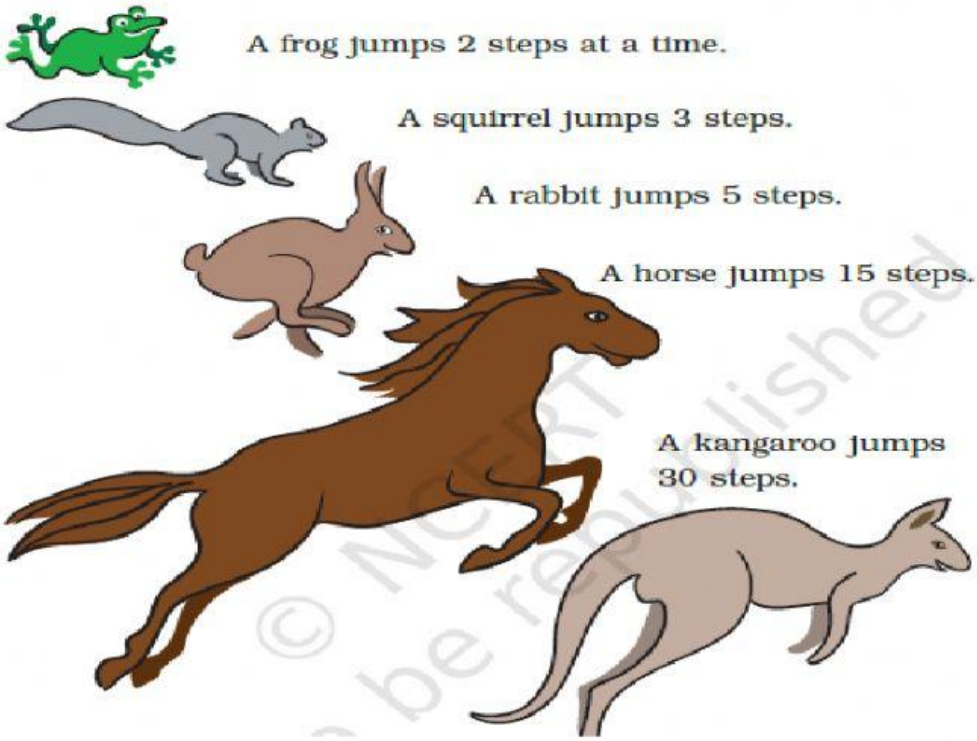

© NCERT not to be republished

a- In how many jumps will the frog reach 30?

30÷ 2 =

b- In how many jumps will the squirrel reach 27?

27 ÷ 3 =

c- Will the rabbit ever be at the number 18? (yes / no)

Ans-

d- Which is the smallest number where the frog and the squirrel will meet?

Ans-

LIVEWORKSHEETS