Name:_____

Mathematics

Tens and Ones to 50

Look at the tens and ones blocks. Write the correct digit in the space provided.

1. 

Tens	Ones

2. 

Tens	Ones

3. 

Tens	Ones

4. 

Tens	Ones

5. 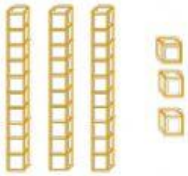

Tens	Ones