SD AL FALAH DARUSSALAM 2 (ICP)

Penilaian Tengah Semester (PTS) 2

Tahun Pelajaran 2020 - 2021

Full Name: ..... Subject : .....

Class : ..... Attendance List: ..... Date : .....

Please Retype This Sentence: "I am honest Kid. I'll do the best for Allah"

.....

Bismillaahirrohmaanirrohiim

Fill the blanks with the correct answer.

1. These are the list of line characteristics:
   A. Eventually cross and form right angles
   B. Eventually cross
   C. Never touch [2]
   D. None of the above
   Which one is the characteristic of intersecting line? _____
2. These are the list of line characteristics:
   A. Never touch
   B. Intersect
   C. Intersect and form right angles [2]
   D. Stop upon intersection
   Which one is the characteristic of perpendicular line? _____
3. These are the list of line characteristics:
   A. Will never cross
   B. Will eventually cross
   C. Intersect [2]
   D. From right angles
   Which one is the characteristic of parallel line? _____

LIVEWORKSHEETS

4. Look at the picture. Line KL and MN are _____

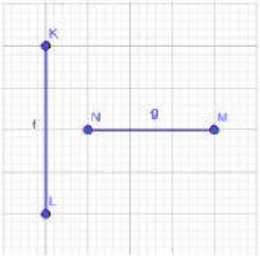

[2]

5. Tick (√) the intersecting lines.

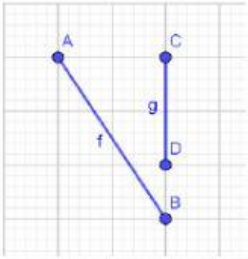

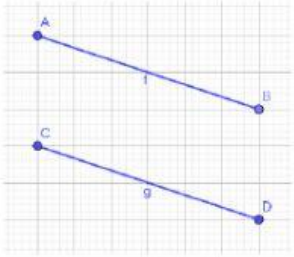

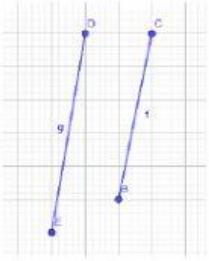

[6]

6. Look at the picture. Line BC and DE are _____

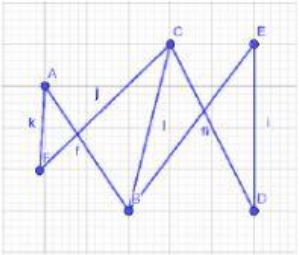

[2]

7. Look at the picture. Line AB and CD are _____

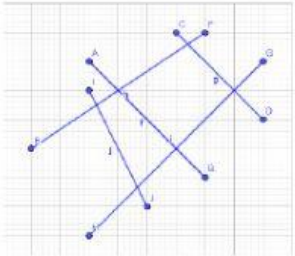

[2]

8. Tick (√) the perpendicular lines.

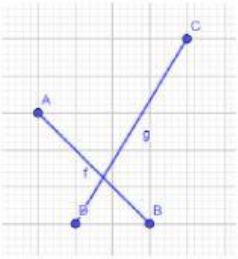

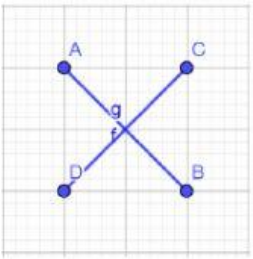

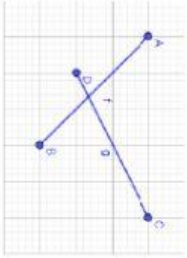

[6]

LIVEWORKSHEETS

9. Tick (√) the nets of the cube.

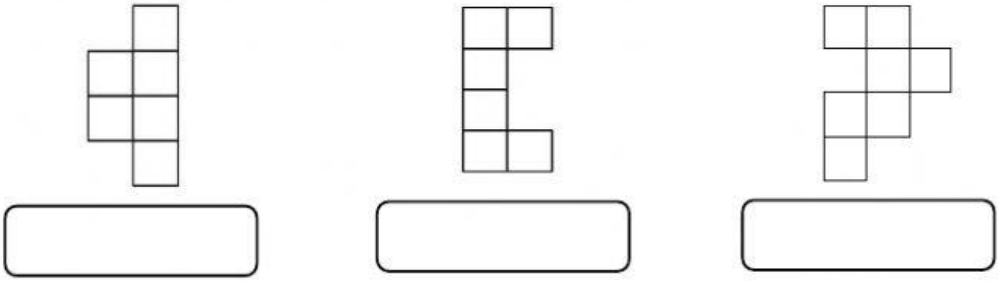

[6]

10. I am 3D shape. I am made up of 2 triangles and 3 rectangles. I am a _____ [2]

11. Asma had 3560 beads. She sold 3392 beads and packed the remaining beads equally into 8 bags. The beads in every bag is _____ beads. [2]

12. The 4th multiple of 14 is _____ [2]

13. Look at these numbers.

500 305 200 190 87 73 70 65 52 44 36

There are two answers. The numbers that are divisible by 5 but not by 10 are _____ and _____ [2]

14. 1 am a factor of 45. I am between 10 and 20. I am _____ [2]

15. Write "**True**" or "**False**" next to each statement below about factors and multiples.

a. Factors are limited
b. Factors are unlimited
c. Multiples are finite
d. Multiples are infinite
e. Factors only use multiplication
f. Factors use multiplication and division
g. Multiples only use multiplication
h. Multiples use multiplication and division

[8]

16. Look at the picture below.

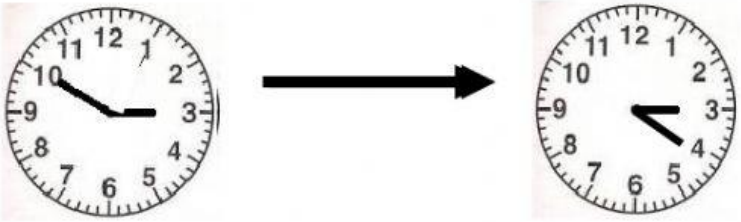

[2]

The second hand has moved _____ minutes.

LIVEWORKSHEETS

17. Asyifa and Rania go home together at 12.30 pm.

Asyifa arrived at 1.15 pm while Rania took 35 minutes to get home.

What time did Rania get home? Rania arrived at _____pm. [2]

18. Abdul opens his shop at 10.30 am and closes it at 7 pm every day. How long is the shop open _____h _____ min. [2]

19. Ahmad was born on 16th May 2008. Somad is 7 months younger than him. Somad was born on _____ [2]

20. When I double my number, I get 1480. I am _____

21. Match the 3D shapes to their nets by writing the letters in the box provided. [2]

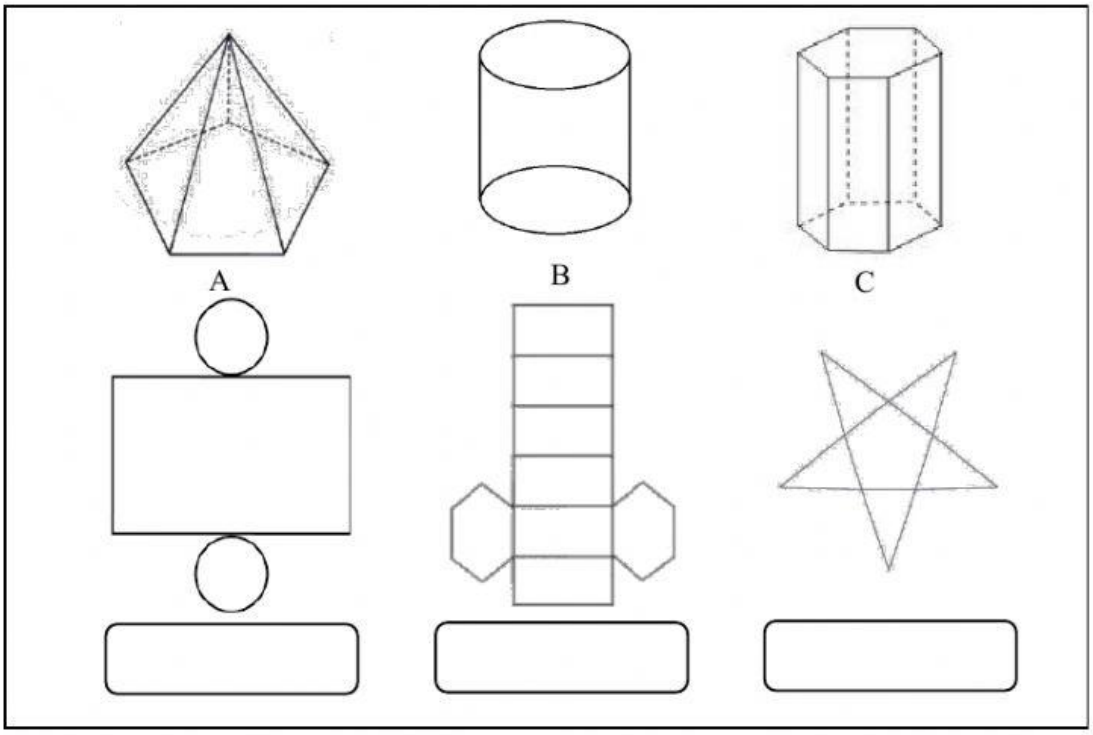

[8]

22. I am a 2-digit square number.

I am divisible by 2.

I have a factor 9.

What number am I? _____ [6]

23. Write the five multiples of the number.

a. 9 = **9** , _____ , _____ , _____ , and _____ [6]

b. 11 = _____ , **22** , _____ , _____ , and _____

24. Divide 84 by 5 = _____ remainder _____ [2]

25. Express each of the following in seconds.

a. 15 minutes =_____ seconds b. 7 minutes 20 seconds = _____ seconds [2]

LIVEWORKSHEETS

26. What is the time shown on each of these clocks?

Express your answer in 24-hour clock notation.

a.

night

_____

b.

afternoon

_____

[6]

27. Namia boarded the school bus at 06.45. The ride took 18 minutes. What time did Namia arrive at school? Express your answer using 24-hour clock _____ [2]

28. Write the missing numbers.

a. 15th May → 5th June

_____ weeks _____ days later

b. 10th January → _____

8 days later

[6]

29. Abdul planted some mangrove seedlings in September 2012. The seedlings grew into trees in November 2017. How long did the seedlings grow into trees? [2]

_____ months

30. Write this clock using 24-hour clock and 12-hour clock.

night

24-hour clock : _____

12-hour clock : _____

[2]

Alhamdulillahirobbilalamin

LIVEWORKSHEETS

LIVEWORKSHEETS