Soal Mencocokkan

Bentuk – Bentuk Bangun Datar

Nama : .....
Kelas : .....
No Absen : .....



Persegi

Lingkaran



Trapesium



Segitiga

LIVEWORKSHEETS