Cambridge Assessment International Education
Cambridge International School

Cambridge Primary Programme **CAMBRIDGE PRIMARY MATHEMATICS 1**

REVISION 2

Name: _____ **Date:** _____ **Class:** _____

1. Count, read and match.

8		nine
1		four
3		seven
7		one
2		five
10	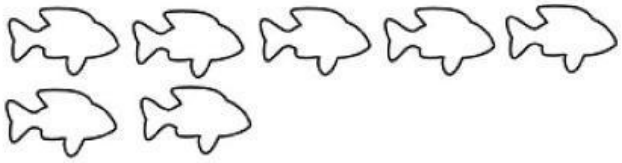	eight
4		two
9		ten
6		three
5		six

LIVEWORKSHEETS

2. Write the missing numbers.



3. Compare the sets.

(a) Tick (✓) the set that has more animals.





(b) Tick (✓) the set that has fewer animals.

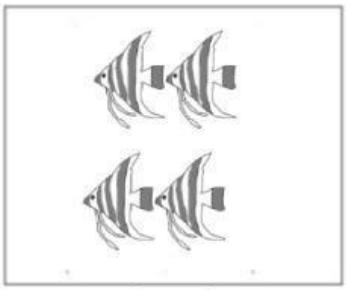

LIVEWORKSHEETS

(c) Tick (✓) the sets that have an equal number of food items.

☐



☐

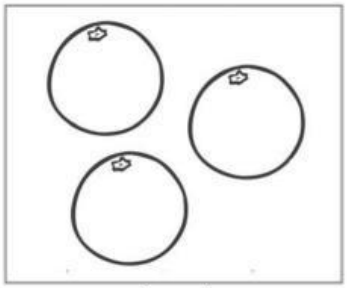

☐

4. Compare the sets. Complete the sentences.



dogs



fish

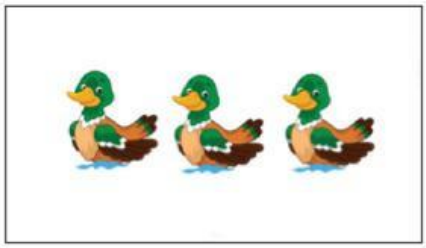

ducks

three	the same	nine	more	fewer	three

There are _____ ducks, _____ fish and _____ dogs.

The number of dogs and ducks is _____ .

There are _____ ducks than fish

so there are _____ fish than ducks.

LIVEWORKSHEETS

5. Answer these questions.

a. Which number is 2 fewer than 6? ☐

b. Which number is 5 more than 2? ☐

c. What is the next odd number after 7? ☐

d. What is the next even number after 6? ☐

6. Count and write.



How many? _____

Even or Odd? _____



How many? _____

Even or Odd? _____



How many? _____

Even or Odd? _____



How many? _____

Even or Odd? _____



How many? _____

Even or Odd? _____

How many? _____

Even or Odd? _____

LIVEWORKSHEETS

7. Draw lines to match the shape names and shapes.

a pyramid

b sphere

c cube

d cuboid

e cylinder

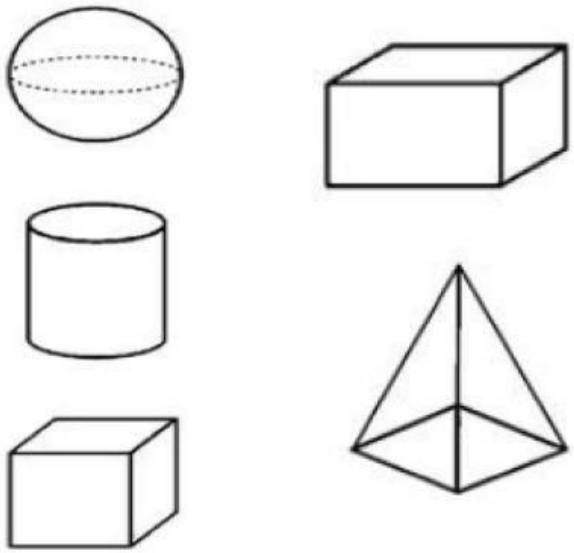

8. Choose these words to label this picture.

flat	curved	faces	edges

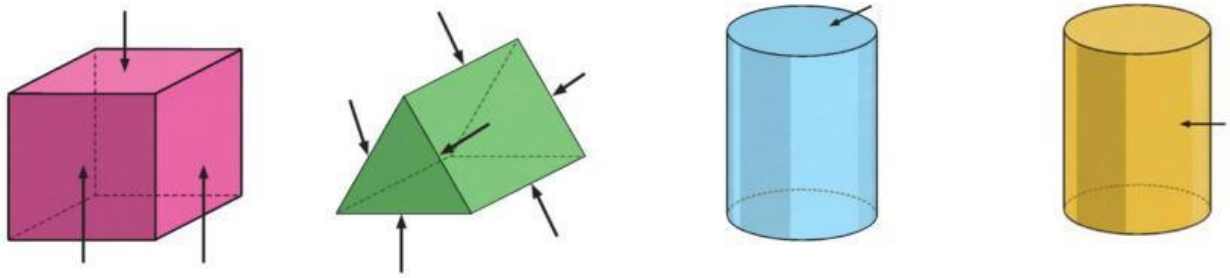

.... face ..... surface

LIVEWORKSHEETS

9. Fill in the blanks.

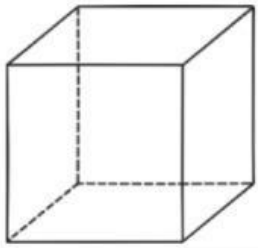

cube

edges _____

faces _____

Cuboid

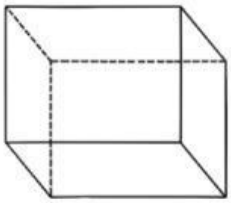

edges _____

faces _____

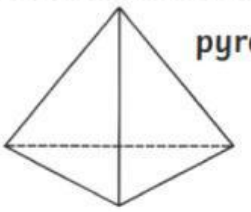

pyramid

edges _____

faces _____

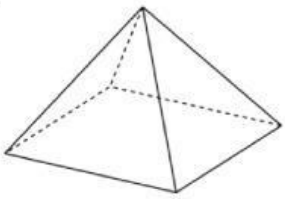

pyramid

edges _____

faces _____

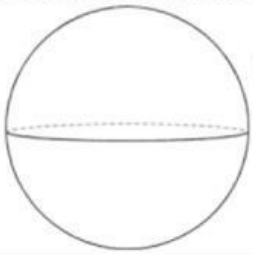

sphere

edges _____

curved surfaces _____

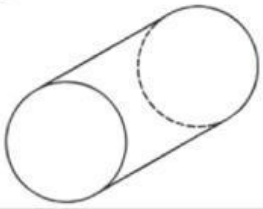

cylinder

edges _____

flat faces _____

curved surfaces _____

10. Read and circle.

a. Circle the object that can roll.

b. Circle the objects that can stack.

LIVEWORKSHEETS