Cambridge Assessment International Education
Cambridge International School

Cambridge Primary Programme **CAMBRIDGE PRIMARY MATHEMATICS 1**

INDENTIFY 3D SHAPES

Name: _____ **Date:** _____ **Class:** _____

1. Write the name of each shape.

cylinder cuboid sphere cube pyramid

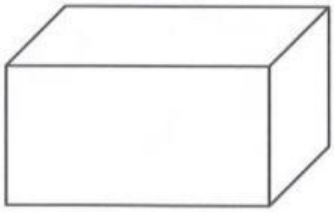

_____

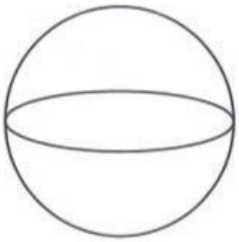

_____

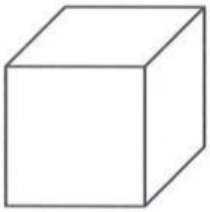

_____

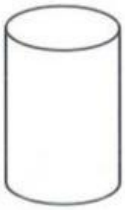

_____

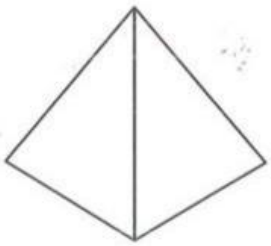

_____

2. Choose the correct shape.

cube

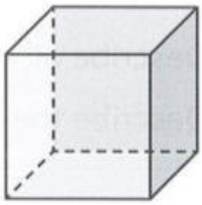

pyramid

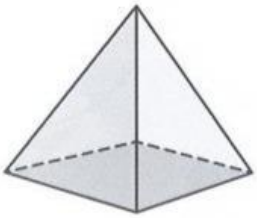

LIVEWORKSHEETS

cuboid



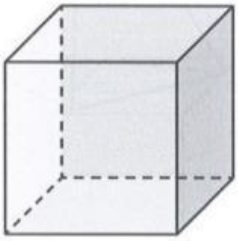

cylinder

3. Choose the correct word.



cylinder sphere pyramid

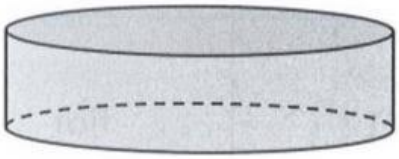

pyramid sphere cylinder

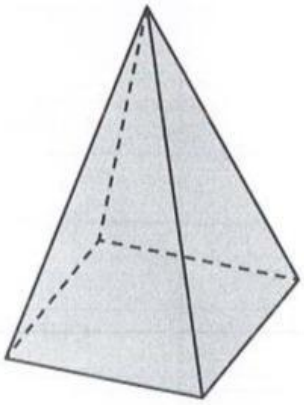

sphere cuboid pyramid

LIVEWORKSHEETS

4. Choose the correct shape.

This is a cube.

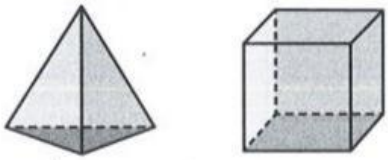

This is a pyramid.

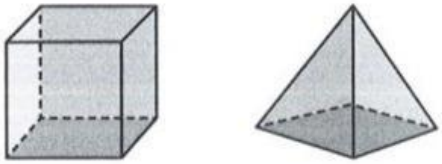

This is a cuboid.

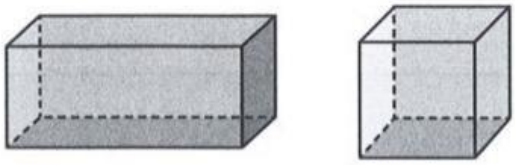

This is a square-based pyramid.



5. Write the name of the shape that each object looks like.

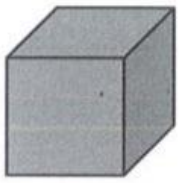

cube

sphere

cylinder

_____ _____ _____

_____ _____ _____

LIVEWORKSHEETS