2.3 GARIS MASA ZAMAN AIR BATU

1. Nyatakan tahap zaman air batu. TP 3 ms 32

MIOSEN (23 - 5 juta tahun)			HOLOSEN (10000 tahun - kini)

2. Namakan hidupan berikut dengan betul. Ms 32

			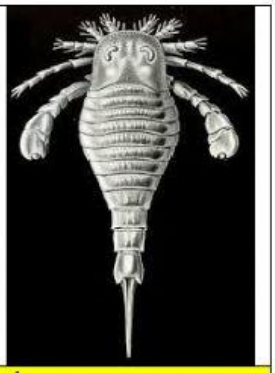
a.	b.	c.	d.

			
e.	f.	g.	h.

Dipterus	Eurypterids	Coiled Cephalopod	Stegosaurus
Diatryma	Trilobite	Deinotherium	Hyracotherium

LIVEWORKSHEETS