Cambridge Assessment International Education
Cambridge International School

Cambridge Primary Programme

CAMBRIDGE PRIMARY SCIENCE 2

END-TERM 1 REVIEW

WORKSHEET 2

Name: _____ **Date:_____** **Class:_____**

Part 1. Match these materials with where they come from.

• •

• •

• •



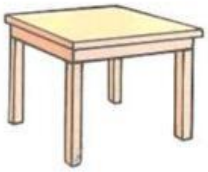

• •

LIVEWORKSHEETS

Part 2. Complete the sentences.

wood	sand	oil	nature

a. Plastic comes from …….. .

b. Paper comes from …….. .

c. Glass comes from …….. .

d. Water comes from …….. .

Part 3. Look at following pictures and put a tick (✔) in the box.

	Natural materials	Man-made materials
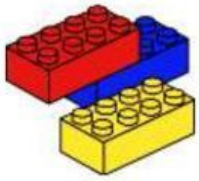 plastic		
glass		
rock		

LIVEWORKSHEETS

oil		
paper		
wood		

Part 4. Read the following statement and put a tick (✔) in corect box.

	TRUE	FALSE
a. Forces can't make things stop.	☐	☐
b. Pushes and pulls can make moving objects turn.	☐	☐
c. Natural materials come from nature.	☐	☐
d. Forces can make moving objects change direction.	☐	☐

LIVEWORKSHEETS

Part 5. Choose a word to fill in the blank to describe the picture.

shape	direction	speed

a. change …….

b. change …….

c. change …….

Part 6. Look at the pictures of natural resources and the materials we make from them. **Choose the correct material for each resource and write it in the box.**

metal	wood	paper	plastic

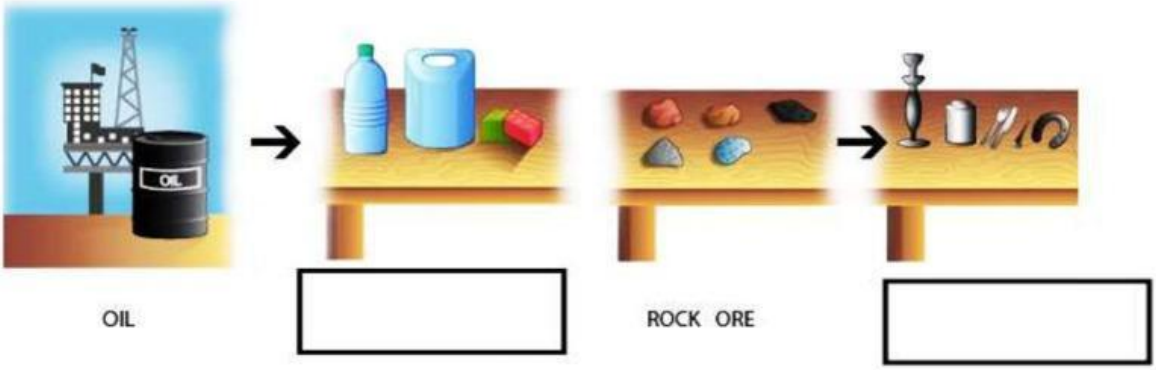

LIVEWORKSHEETS