ASESMEN PENILAIAN PENDIDIKAN INKLUSI

LINGKARAN

Kelompok 4

LIVEWORKSHEETS

Nomor 1

LEFT OR RIGHT

Manakah yang merupakan bentuk lingkaran?



Kiri	Kanan

Kelompok 4

LIVEWORKSHEETS

Nomor 2

Manakah benda yang berbentuk lingkaran?

LIVEWORKSHEETS

PasangKan unsur lingKaran dibawah ini

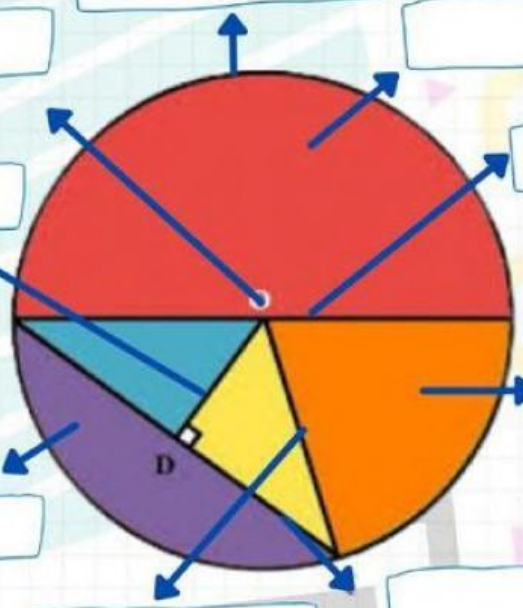

keterangan:

1. Titik Pusat
2. Diamete (d)
3. Jari-Jari (r)
4. Busur
5. Tali Busur
6. Apotema
7. Juring
8. Tembereng

Nomor 3

LIVEWORKSHEETS

Nomor 4

Manakah rumus Keliling lingkaran

$2 \times \pi \times r$

$\pi \times r \times r$

$2 \times \pi \times r \times r$

LIVEWORKSHEETS

Nomor 5

QUIZ TIME

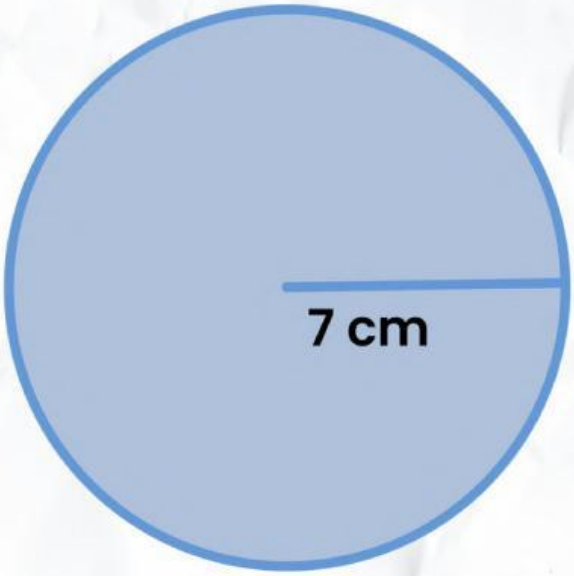

Berapakah keliling lingkaran di samping

A. 21 cm

B. 44 cm

C. 7 cm

D. 22 cm

LIVEWORKSHEETS