Vārds:_____

Laukumi!

1. Sakārto trijstūra leņķus augošā secībā! (4 punkti)

1)

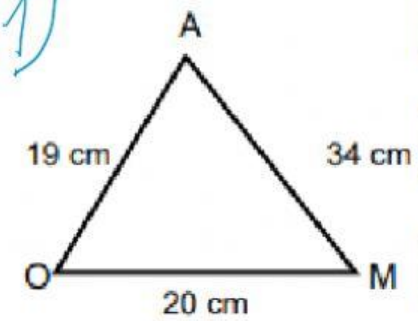

1. _____
2. _____
3. _____

2)

Δ PUF

PU = 17 m

FP = 12 m

UF = 11 m

1. _____
2. _____
3. _____

3)

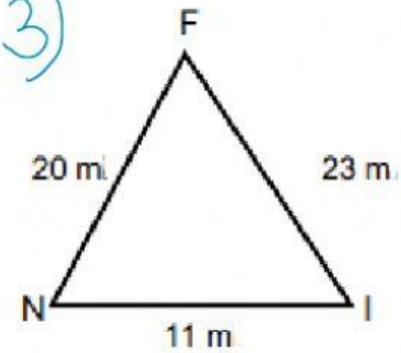

1. _____
2. _____
3. _____

4)

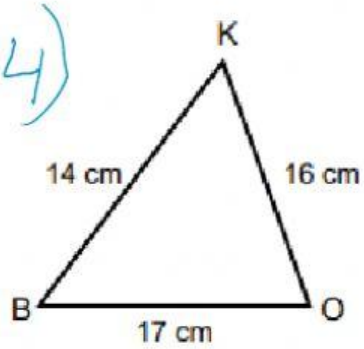

1. _____
2. _____
3. _____

2. Sakārto trijstūra malas augošā secībā! (4 punkti)

1)

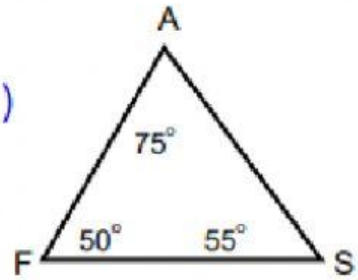

1. _____
2. _____
3. _____

For Δ DZR

m ∠ S = 55°

m ∠ D = 50 °

m ∠ R = 65°

1. _____
2. _____
3. _____

LIVEWORKSHEETS

3.uzdevums. Aprēķini nezināmo leņķu lielumus!

1)

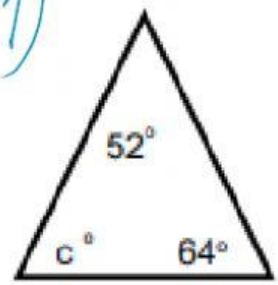

c = 0

2)

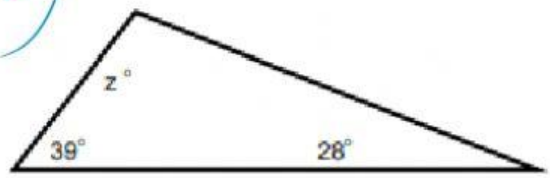

z = 0

3)

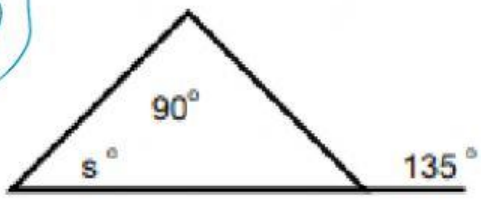

s = 0

4)

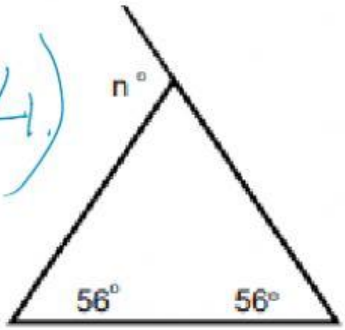

n = 0

4.uzdevums. Aprēķini trijstūra leņķus, ja dota attiecība, risinājumu raksti kladē!

1:2:3

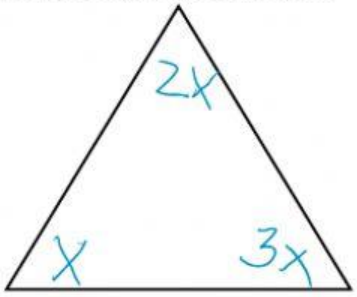

1 = 0

2= 0

3= 0

3:5:8

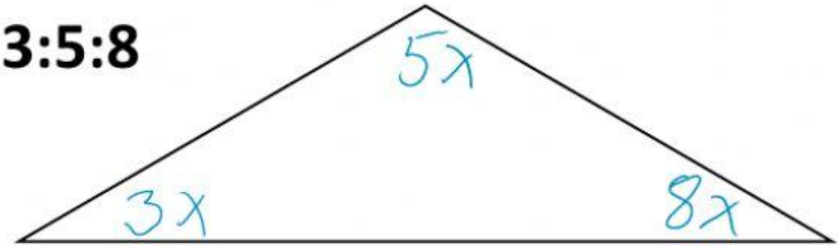

3= 0

5= 0

8= 0

LIVEWORKSHEETS