Name_____

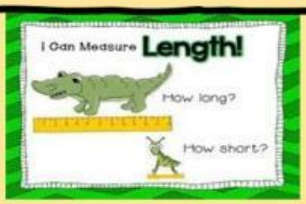

Metric Conversion

Meters to centimeter

Centimeters to meters

©ACsWorksheet
LIVEWORKSHEETS

1. Shade 7 cm

Complete:

7cm = _____mm

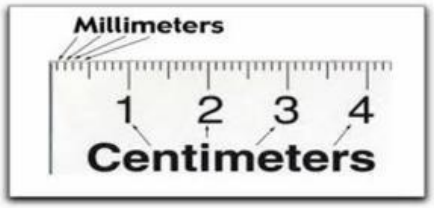

©ACsWorksheet
LIVEWORKSHEETS

2. Shade 14 cm

Complete:

14 cm = _____mm

©ACsWorksheet
LIVEWORKSHEETS

3. Shade 1 cm

Complete:

1 cm = _____mm

©ACsWorksheet
LIVEWORKSHEETS

4. Shade 15 cm

Complete:

15 cm = _____mm



©ACsWorksheet
LIVEWORKSHEETS

5. Shade 9 cm

Complete:

9 cm = _____mm

©ACsWorksheet
LIVEWORKSHEETS

6. Shade 12 cm

Complete:

12 cm = _____mm

©ACsWorksheet
LIVEWORKSHEETS

7. Shade 20 cm

Complete:

20 cm = _____mm

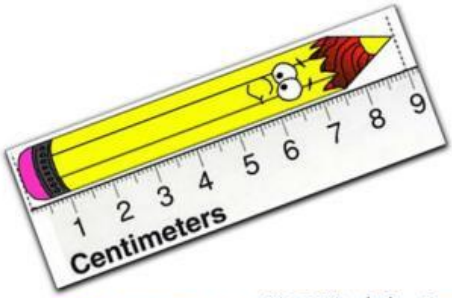

©ACsWorksheet
LIVEWORKSHEETS

Remember to change a **large unit** to a **smaller unit** – multiply by 10

8 cm = 80 mm

8 x 10 = 80

Now do these.

1. 6 cm = _____mm
2. 13 cm = _____mm
3. 24 cm = _____mm

(4) 19 cm = _____mm

(5) 1 cm = _____mm

(6) 60 cm = _____mm

©ACsWorksheet
LIVEWORKSHEETS

7. 65 cm = _____mm

8. 3 cm = _____mm

9. 74 cm = _____mm

10. 325 cm =_____mm

11. 10 cm = _____mm

12. 29 cm = _____mm

13. 93 cm = _____mm

(14) 70 cm = _____mm

(15) 3 cm = _____mm

(16) 115 cm = _____mm

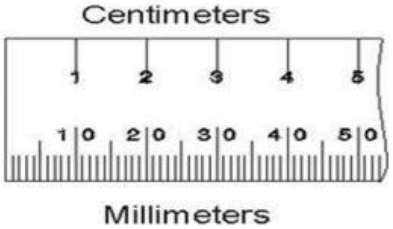

©ACsWorksheet
LIVEWORKSHEETS