Evaluación

1. Hallar el area total del cubo:

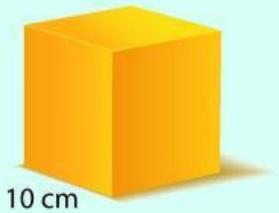

Área =

2. Une con una linea el area correcta:

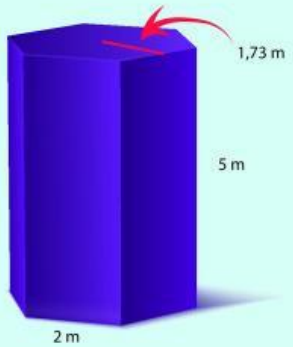

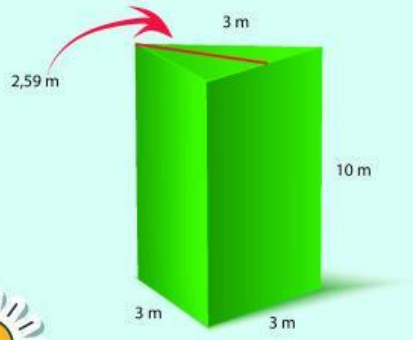

$97,77\ m^2$

$80,76\ m^2$

$95,81\ m^2$

$74,34\ m^2$

3. Calcula el volumen del cono:

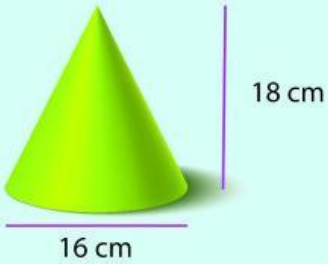

a) $1200,3\ cm^3$

b) $2002,6\ cm^3$

c) $1206,37\ cm^3$

d) N.A.

LIVEWORKSHEETS