MEMBUAT SOAL LKPD LIVEWORKSHEET

Soal pilihan ganda:

Dibawah ini yang merupakan gambar dari persegi Panjang adalah.....

Soal isian singkat:

Segitiga yang salah satu sudutnya 90 derajat disebut segitiga.....

Soal drop down:

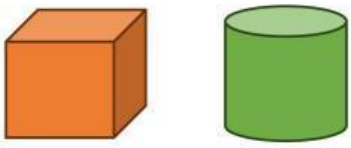

Soal chek box:

Yang merupakan bagian dari bangun ruang sisi datar adalah:

kubus

Prisma

Tabung

Limas

Soal join arrow:

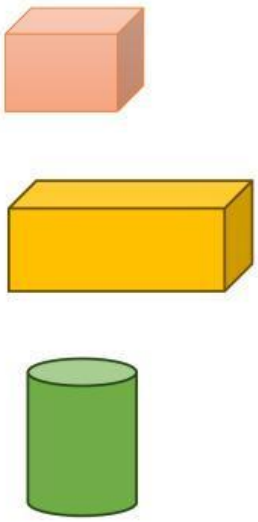

LIVEWORKSHEETS

Soal drag and drop:

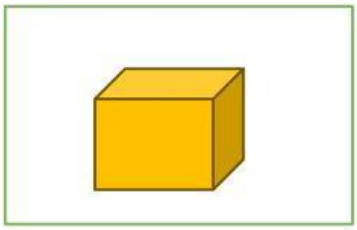

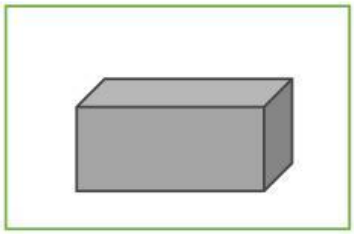

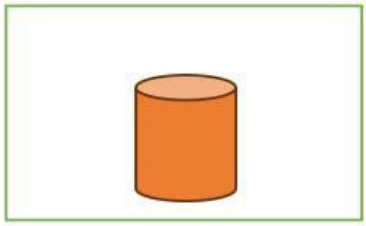

Pindahkan bangun ruang diatas ke kotak yang tepat!

Kubus

Balok

Tabung

Soal listening:

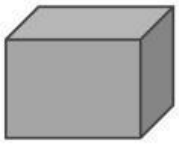

Benar

Salah

Benar

Salah

Soal speaking:

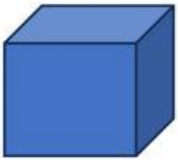

LIVEWORKSHEETS

Soal work search

Cari kata kubus

A	K	U	B	U	S	P	O
Q	V	M	A	I	O	O	B
W	P	R	I	S	M	A	A
R	D	J	B	T	D	A	L
T	U	O	V	C	G	A	O
L	I	M	A	S	B	H	K
Y	T	A	I	Y	R	J	V

LIVEWORKSHEETS