Tens and Ones

Write the numeral name and the groups of tens and ones for the base ten blocks in the pictures.

Base Ten Blocks	Tens and Ones	Numeral and Number Name
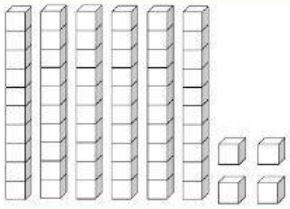	6 tens and 4 ones	64 sixty-four
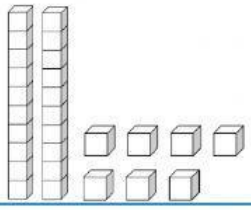	___ tens and ___ ones	_____ _____
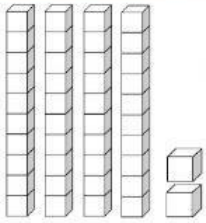	___ tens and ___ ones	_____ _____
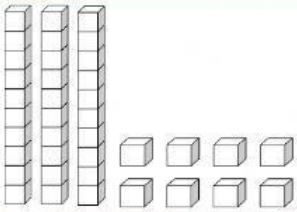	___ tens and ___ ones	_____ _____
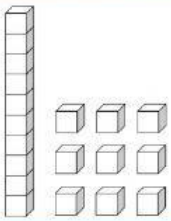	___ tens and ___ ones	_____ _____
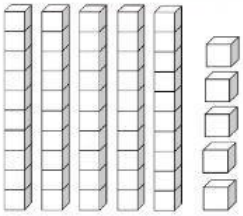	___ tens and ___ ones	_____ _____
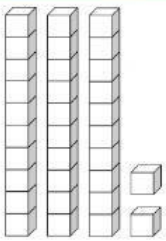	___ tens and ___ ones	_____ _____

LIVEWORKSHEETS

6 tens and 4 ones = 64

2 tens and 7 ones = _____

4 tens and 2 ones = _____

3 tens and 8 ones = _____

1 ten and 9 ones = _____

5 tens and 5 ones = _____

3 tens and 2 ones = _____



LIVEWORKSHEETS