COLEGIO EUROPEO PANAMÁ

TERCER TRIMESTRE

EJERCICIO DE MATEMATICAS

TEMA: PERÍMETRO Y ÁREA

Estudiante: _____ Grado: 1°

Docente: NADINA E. SALGADO Fecha: 30/10/23

**I. Calcule el perímetro de las siguientes figuras y escribe el resultado. Hay que escribir correctamente para que la página corrija, no usar espacios. Ejm. 3+4+7+2+4=20**

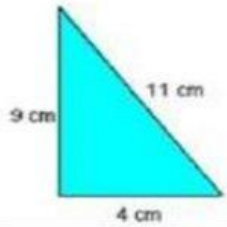


P=




P=

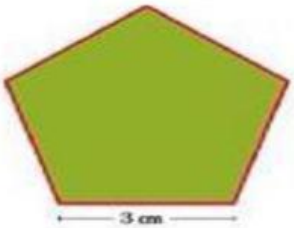


P=

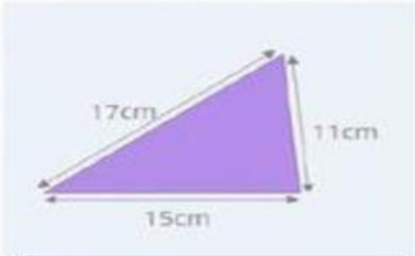


P=

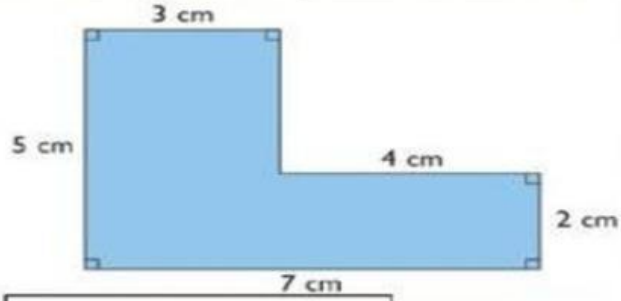


P=

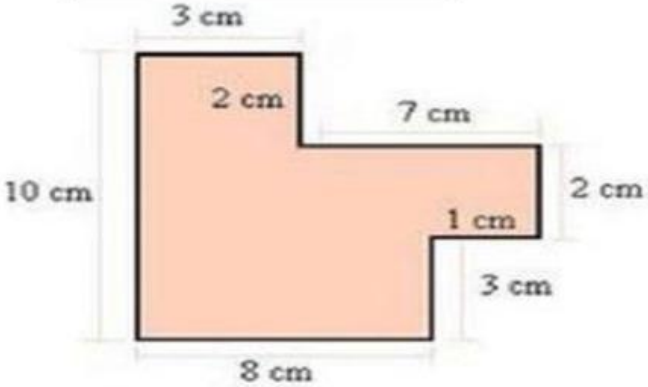


P=

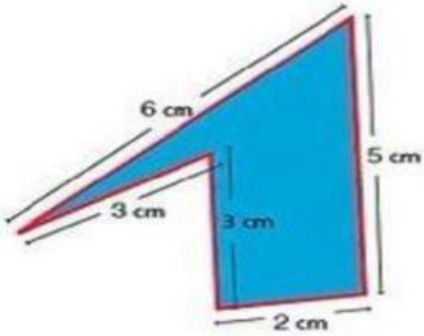


P=

LIVEWORKSHEETS

**II. Calcule el área de cada figura, cuente con mucho cuidado.**

1



Area = _____

2



Area = _____

3



Area = _____

4



Area = _____

5

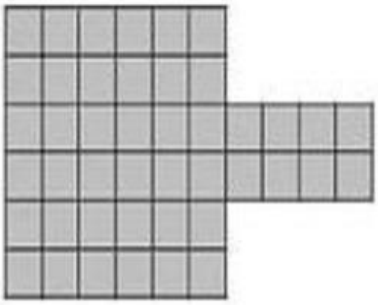

Area = _____

6



Area = _____

LIVEWORKSHEETS

**III. Observe las siguientes imágenes y calcula el perímetro y área. Recuerda perímetro es contorno y área es interno.**

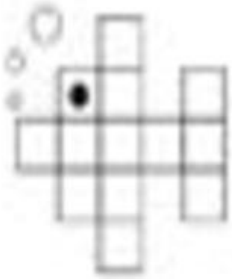

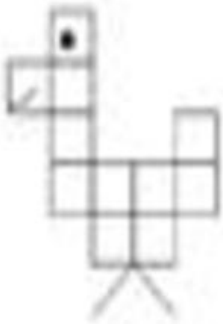

**Perímetro:** _____

**Área:** _____

**Perímetro:** _____

**Área:** _____

**Perímetro:** _____

**Área:** _____

Buena suerte

LIVEWORKSHEETS